Codeyoung

Multiply using repeated addition and learn multiplication tables and facts

Application _ Multiplication as Repeated Addition

Answer each question below. Write an addition or multiplication equation to show how you figured it out.

Picture	Answer the question.	Write an equation.
example 	There are 3 flowers. How many *leaves*? 6	2+2+2=6 or 3x2=6
1 	There are 3 flowers. How many *petals*?	

LIVEWORKSHEETS

2 	There are 7 flowers. How many *leaves*?	
3 	There are 4 flowers. How many *petals*?	

1 	There are 10 cats. How many *eyes*?	
2 	There are 6 cats. How many *ears*?	

LIVEWORKSHEETS

3	There are 3 cats. How many *whiskers*?	

LIVEWORKSHEETS