Codeyoung

Concept CW_Grade-7_Lines and Angles

Various Types of Angles

Measures of angles are given below. What is the angle type? Pick the right choice.

1) 44^0

a) Acute angle b) Straight angle c) Obtuse angle

2) 260^0

a) Right angle b) Reflex angle c) Acute angle

3) 90^0

a) Straight angle b) Obtuse angle c) Right angle

Write acute, right, obtuse, straight or reflex angle against each measure.

1) 180^0

_____

2) 312^0

_____

3) 55^0

_____

4) 116^0

_____

5) 130^0

_____

6) 90^0

_____

7) 299^0

_____

8) 19^0

_____

LIVEWORKSHEETS

Codeyoung

Look at the angles shown below. Identify the type of angle.

1)

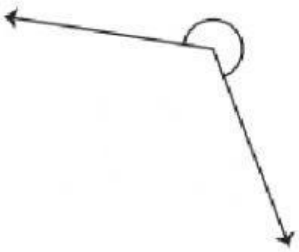

Reflex angle

2)

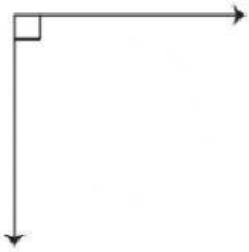

3)

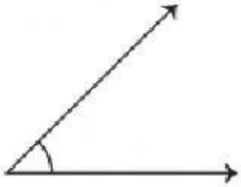

4)

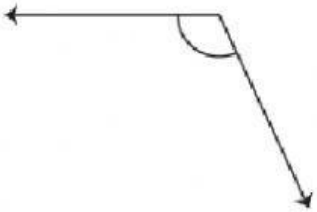

5)

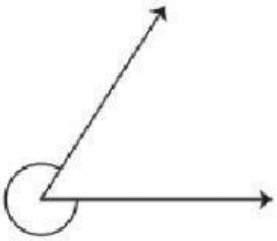

6)

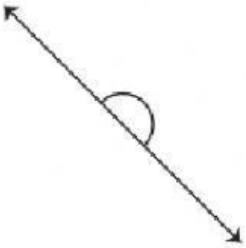

7)

8)

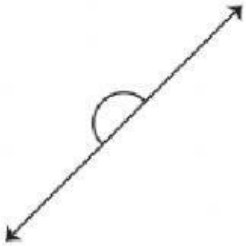

9)

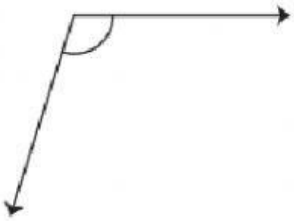

10)

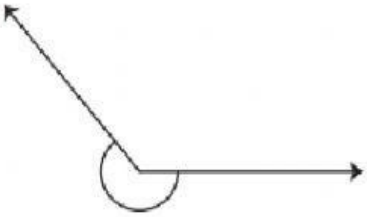

11)



12)

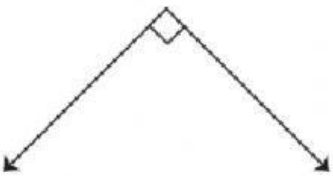

LIVEWORKSHEETS