Codeyoung

Application_Grade-6_Mensuration

The Area of Squares and Rectangles

1 a. Find the area and perimeter of the shape.

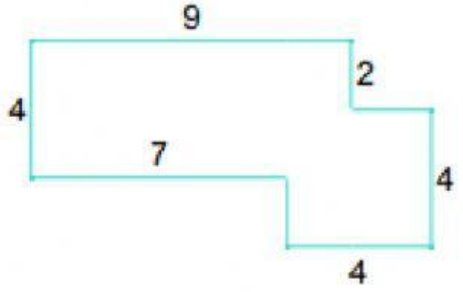

2 a. Find the area and perimeter of the shape.

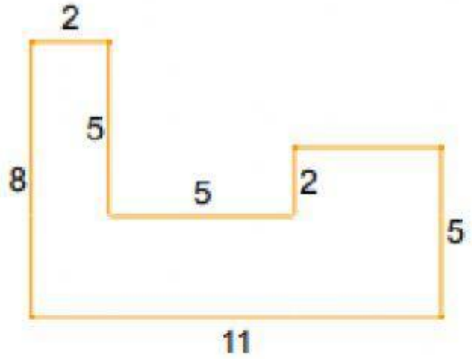

3 a. Find the area and perimeter of the shape.

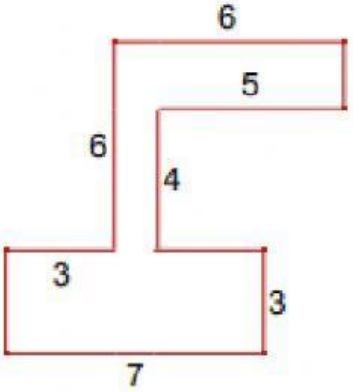

LIVEWORKSHEETS