Name: _____ Date: _____

Mathematics
Area of Basic Shapes

1. Look at each shape carefully, calculate the area.

a)



Area = _____cm^2

b)



Area = _____cm^2

c)



Area = _____cm^2

2. Calculate the area of the shapes below.

a)

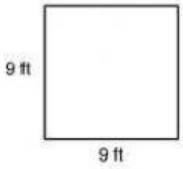

Area = _____ft^2

b)

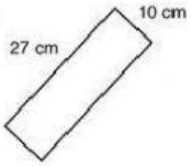

Area = _____cm^2

c)

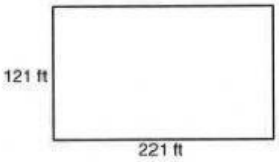

Area = _____ft^2

d)



Area = _____m^2

3. Read the word problem and write your answer on the line provided.

You have a square shaped garden with a length of 48.25 mi and a width of 35.5 mi. What is the area of the garden?

Area = _____mi^2

Created by: Ms. Antonia Bain

pageborders.org