La Tierra

Fablo

4º Actividades

Put the names of the layers of The Earth in the correct place

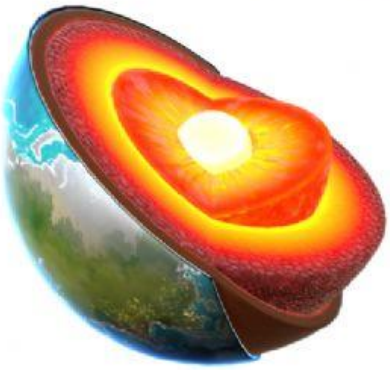

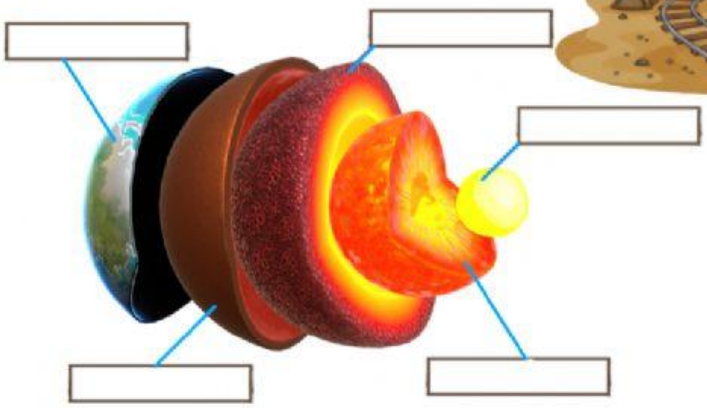

Lower mantle

Outer core

Crust

Upper mantle

Inner core

Select the name of each layer according to its composition

	is compounded by liquid rocks and minerals
	is compounded by nickel and iron
	is compounded by solid rocks

Select the characteristics of the minerals according to their definitions

It's how easy or difficult is it to scrath	
Is the relationship between mass and volume	
It's the way that a mineral reflects the light	
It can appear in grains layers or crystals	
It can be different in the mineral and its streak	

Selecciona para cada foto el tipo de roca correspondiente.



Tipos de roca

LIVEWORKSHEETS