Codeyoung

Application_Grade-5_Fractions

Division of Whole Numbers by Fractions

Divide the whole numbers by unit fractions using the models given.

1)

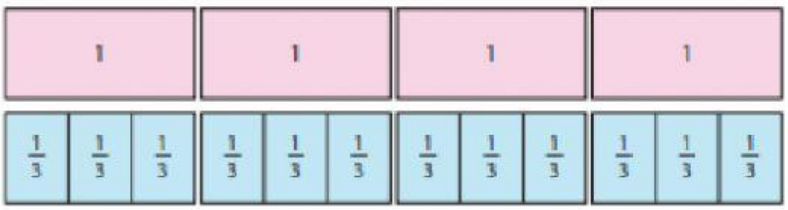

$4 \div \frac{1}{3} = \square$

2)

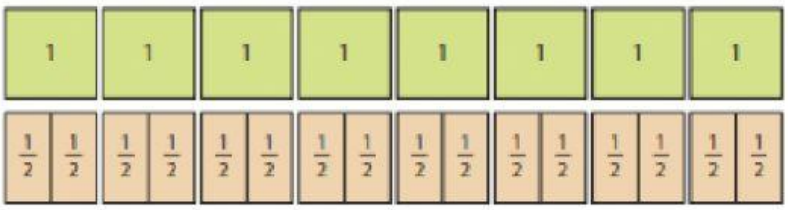

$8 \div \frac{1}{2} = \square$

3)

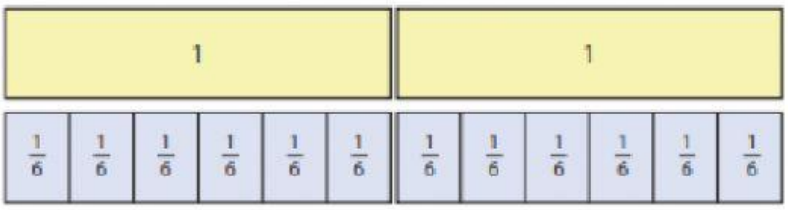

$2 \div \frac{1}{6} = \square$

4)

$7 \div \frac{1}{4} = \square$

5)

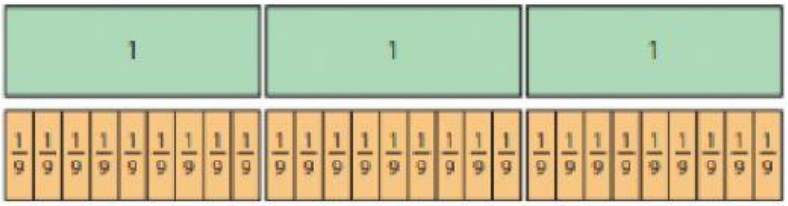

$3 \div \frac{1}{9} = \square$

LIVEWORKSHEETS

Codeyoung

Divide.

1. $\frac{1}{3} \div 2 =$ _____

2. $\frac{2}{3} \div 8 =$ _____

3. $\frac{1}{4} \div 8 =$ _____

4. $\frac{4}{5} \div 8 =$ _____

5. $\frac{1}{12} \div 1 =$ _____

6. $\frac{1}{2} \div 8 =$ _____

7. $\frac{3}{10} \div 2 =$ _____

8. $\frac{6}{8} \div 7 =$ _____

9. $\frac{1}{4} \div 6 =$ _____

10. $\frac{2}{3} \div 2 =$ _____

11. $\frac{8}{10} \div 9 =$ _____

12. $\frac{4}{5} \div 3 =$ _____

13. $\frac{1}{2} \div 2 =$ _____

14. $\frac{7}{8} \div 2 =$ _____

15. $\frac{5}{6} \div 3 =$ _____

16. $\frac{4}{12} \div 6 =$ _____

LIVEWORKSHEETS