Topic : Multiplication

Complete the multiplication sentence that describes the model.

____ × 5 = ____

Complete the multiplication sentence that describes the model.

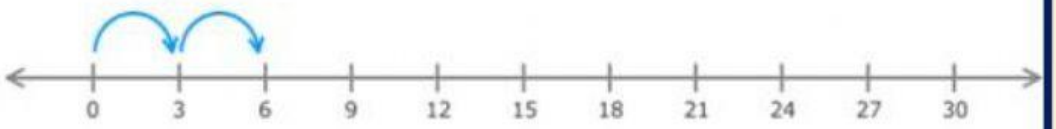

2 × ____ = 6

Complete the multiplication sentence that describes the model.

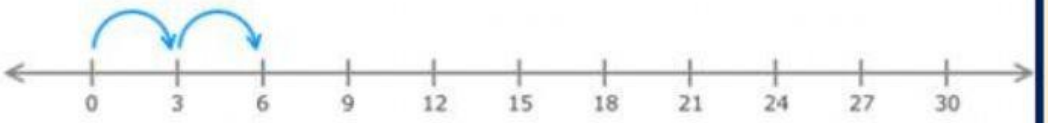

2 × 3 = ____

Complete the multiplication sentence that describes the model.

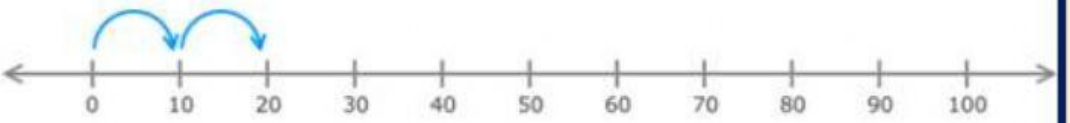

____ × 10 = ____

LIVEWORKSHEETS