POSEM EN PRÀCTICA EL QUE HEM APRÈS

1. **Quines d'aquestes figures és un polígon?**



Aquesta



Aquesta



Aquesta

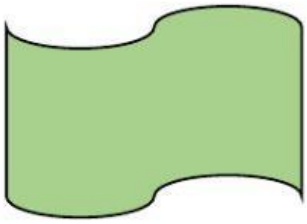

Aquesta

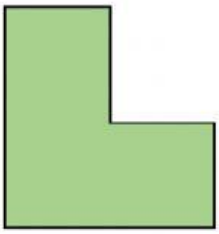

Aquesta

2. **Quins polígons són regulars?**



Aquest

Aquest

Aquest



Aquest

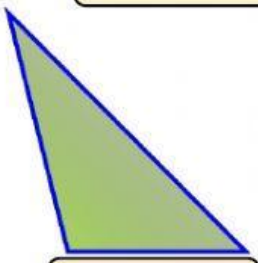

Aquest

3. Quin nom reben aquestes figures?

Quadrilàters

Pentàgons

Hexàgons

4. Relaciona le següents figures amb el seu nom

Pentàgon

Hexàgon

Triangle

Heptàgon

Quadrilàter
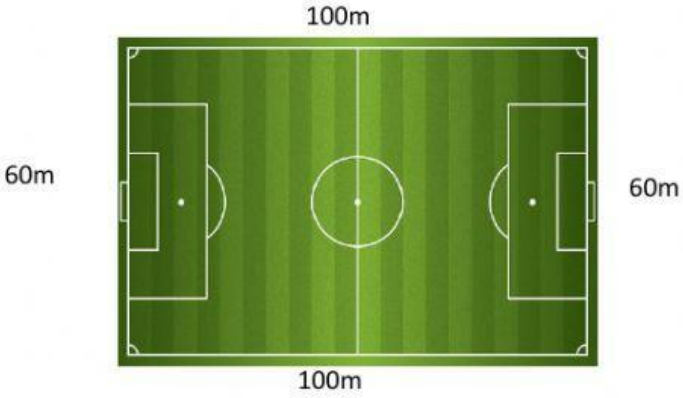
5. Sabries dir-me **el perímetre** d'aquest camp de futbol?