התאימו בין הפונקציה לגרף שלה:

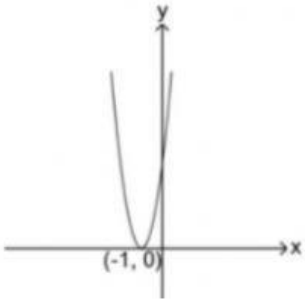

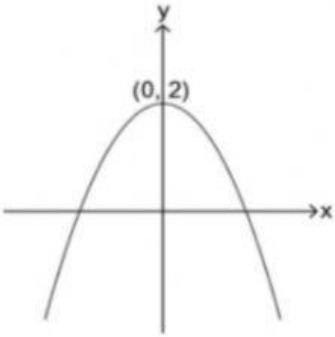

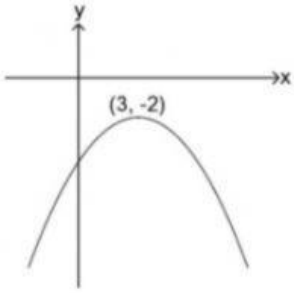

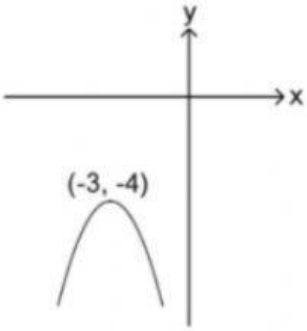

$y = (x+3)^2 + 4$

$y = 4(x+1)^2$

$y = -x^2 + x - 2$

$y = -0.25(x-3)^2 - 2$

$y = -\frac{1}{2}x^2 + 2$

$y = 0.5(x+3)^2 + 2$

$y = -(x+3)^2 - 4$

$y = x^2 - 4$

$y = -2x^2 + 8x - 11$

$\mathbf{f(x) = 2(x-6)^2 - 18}$

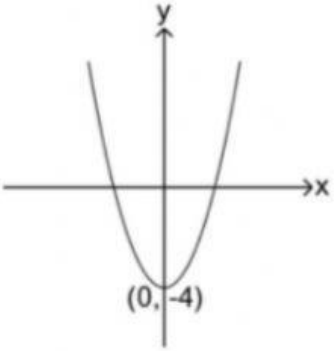

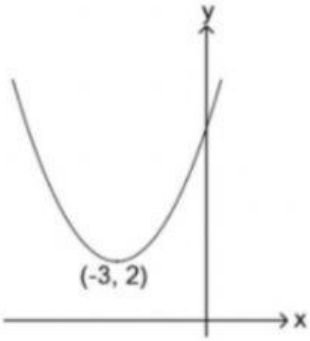

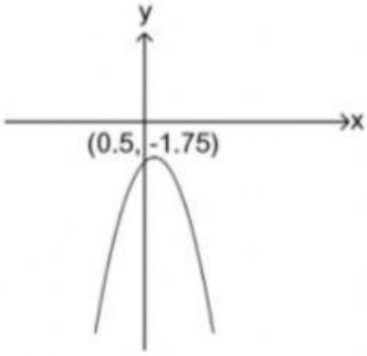

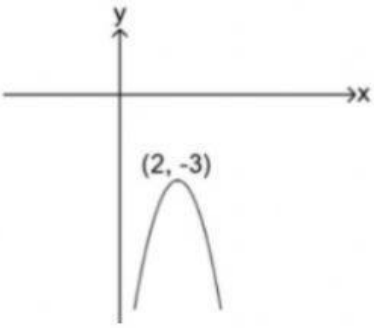

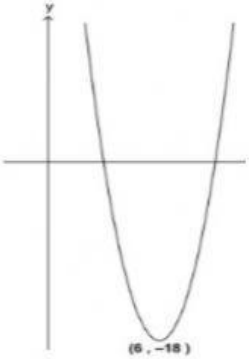

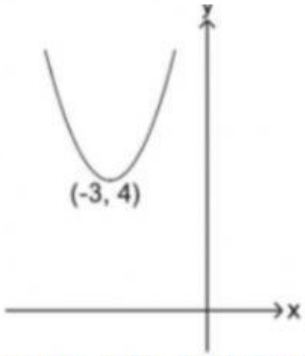

LIVEWORKSHEETS