Codeyoung

Application_Grade-6_Geometry

Complementary and Supplementary Angles

Find the value of x in each right angle.

1)

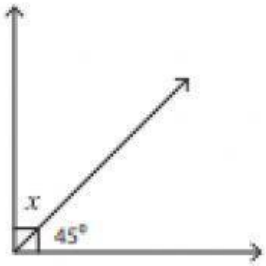

$x =$ _____

2)

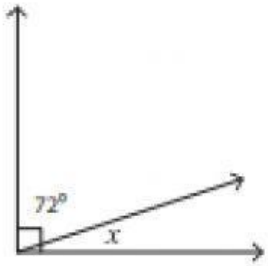

$x =$ _____

3)

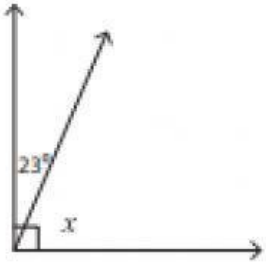

$x =$ _____

4)

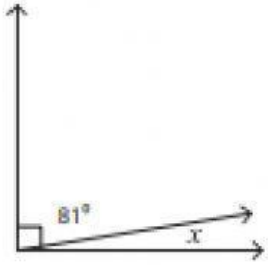

$x =$ _____

5)

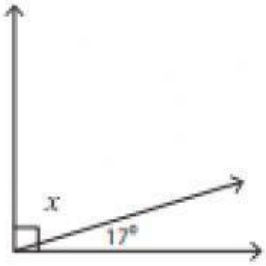

$x =$ _____

6)

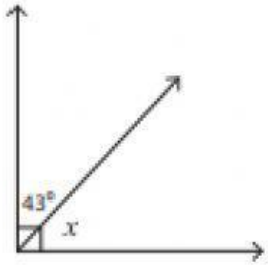

$x =$ _____

7)

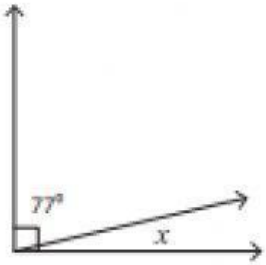

$x =$ _____

8)

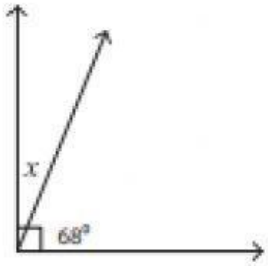

$x =$ _____

LIVEWORKSHEETS

Codeyoung

Find the value of x in each supplementary angle pair.

1)

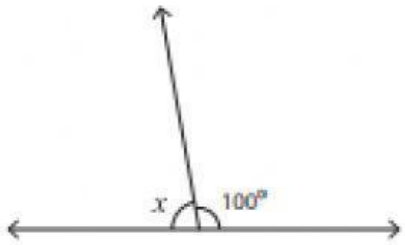

$x =$ _____

2)

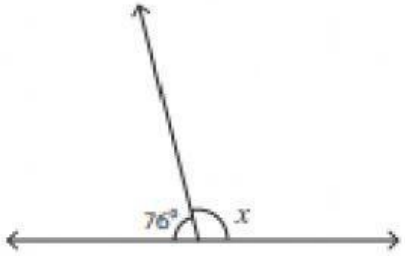

$x =$ _____

3)



$x =$ _____

4)

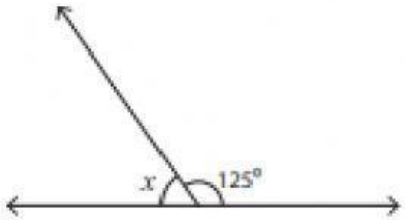

$x =$ _____

5)

$x =$ _____

6)

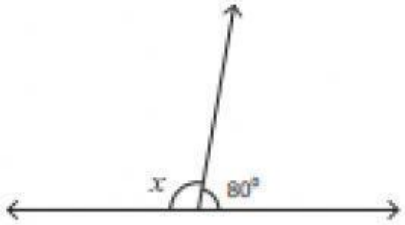

$x =$ _____

7)

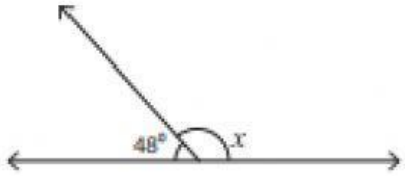

$x =$ _____

8)

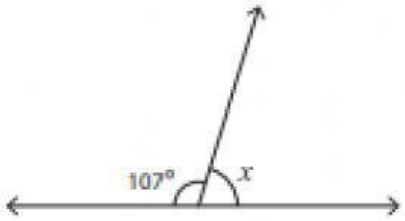

$x =$ _____

LIVEWORKSHEETS