VISUALIZING MULTIPLICATION
Worksheet 2

Direksyon: Paminawa ug sabayi sa pagbasa ang direksiyon.

Pila ka mga lingin o blocks ang naa? Giunsa nato pagkuha kini? Guyura ug dad-a ang *number sentence* sa insaktong lugar niini.

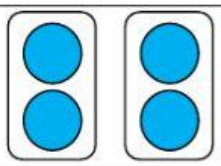

Ibutang dinhi ang tubag

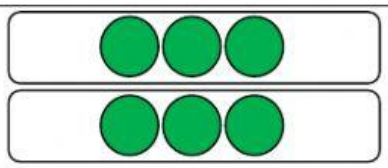

Ibutang dinhi ang tubag

4 x 4

2 x 3

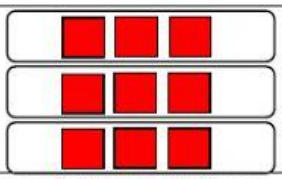

Ibutang dinhi ang tubag

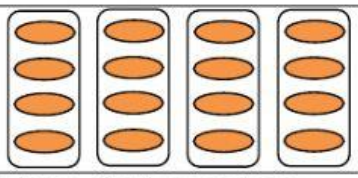

Ibutang dinhi ang tubag

3 x 5

5 x 5

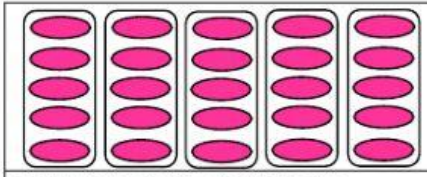

Ibutang dinhi ang tubag

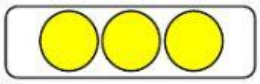

Ibutang dinhi ang tubag

1 x 5

2 x 2

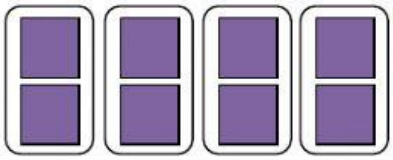

Ibutang dinhi ang tubag

Ibutang dinhi ang tubag

3 x 3

1 x 3

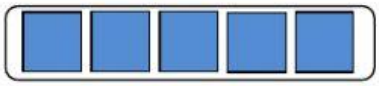

Ibutang dinhi ang tubag

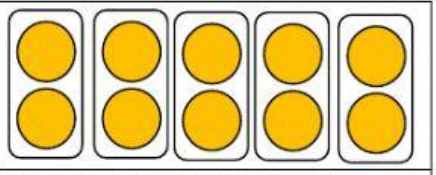

Ibutang dinhi ang tubag

5 x 2

4 x 2

LIVEWORKSHEETS