Name: _____

Count the squares and find the perimeter of each shape.

Remember: Perimeter is the distance around a shape.

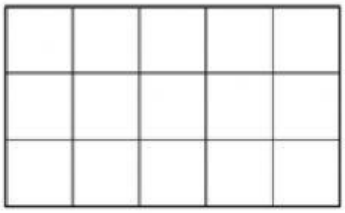

Perimeter _____cm



perimeter = _____cm

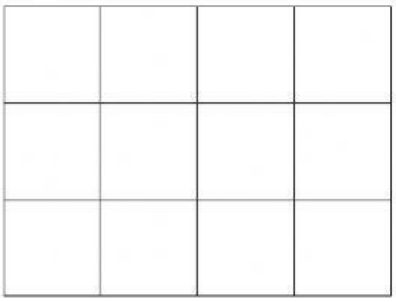

Perimeter = _____cm

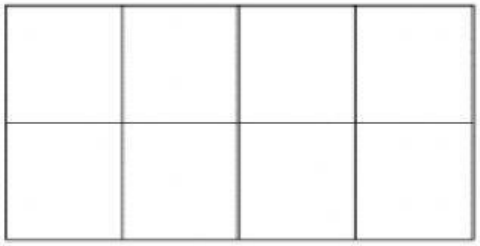

Perimeter = _____cm

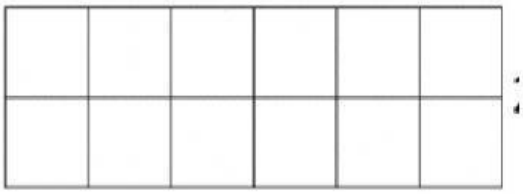

Perimeter = _____cm

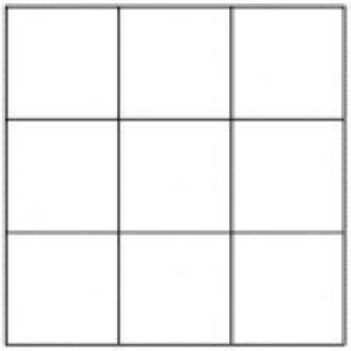

Perimeter = _____ cm

LIVEWORKSHEETS