Codeyoung

Content HW_Grade-5_Fractions

Equivalent Fractions

1.

Does each pair show equivalent fractions? Explain why or why not. Then write the equivalent fractions.

21. 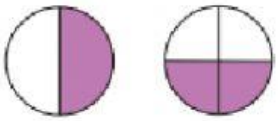

22. 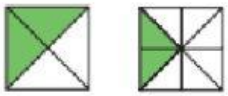

23. 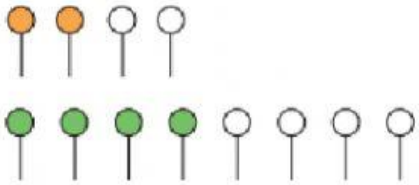

24. 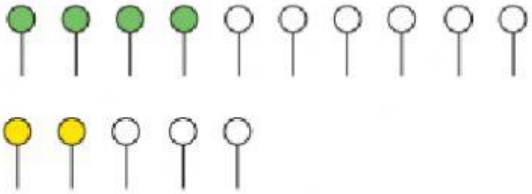

2.

Find the missing numerator or denominator.

28. $\frac{3}{5} = \frac{n}{20}$ **29.** $\frac{a}{7} = \frac{12}{21}$ **30.** $\frac{2}{6} = \frac{8}{x}$ **31.** $\frac{6}{b} = \frac{42}{63}$

32. $\frac{d}{11} = \frac{4}{22}$ **33.** $\frac{7}{y} = \frac{28}{40}$ **34.** $\frac{4}{4} = \frac{12}{f}$ **35.** $\frac{s}{9} = \frac{12}{36}$

36. $\frac{5}{m} = \frac{15}{18}$ **37.** $\frac{6}{8} = \frac{36}{p}$ **38.** $\frac{r}{9} = \frac{21}{27}$ **39.** $\frac{4}{v} = \frac{48}{96}$

3.

Choose the equivalent fraction.

$\frac{3}{6}$

a. $\frac{9}{12}$ **b.** $\frac{6}{18}$ **c.** $\frac{9}{18}$ **d.** $\frac{12}{18}$

LIVEWORKSHEETS