Codeyoung

Showing Distance with a Numberline Name:

Use the numberlines to show each expression and solve.

Ex) Start at 4 and add -8



1) Start at -9 and add 5

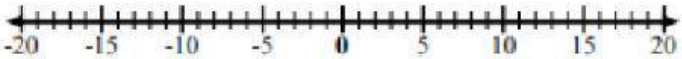

2) Start at -6 and add -4

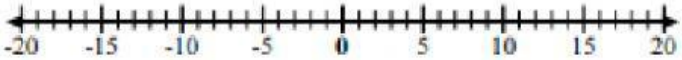

3) Start at -5 and add 4

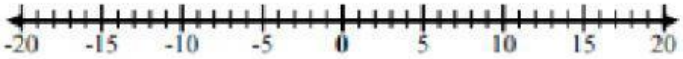

4) Start at -7 and add -2

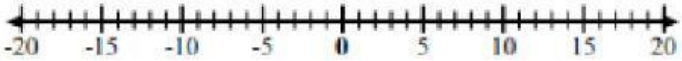

5) Start at 9 and add -12

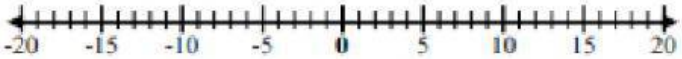

6) Start at 7 and add -3

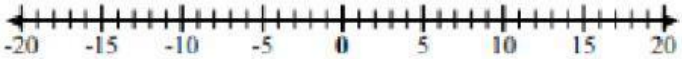

7) Start at 1 and add -11

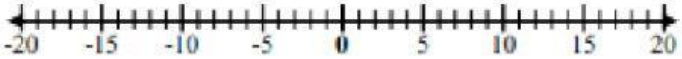

8) Start at -2 and add -3

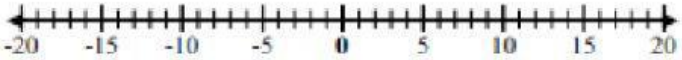

9) Start at -3 and add -3

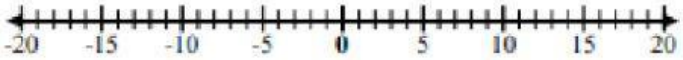

10) Start at -5 and add 2

11) Start at -10 and add 6

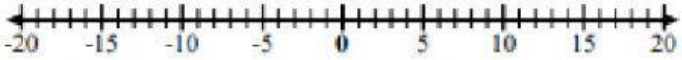

12) Start at -4 and add 8

Answers

Ex. 4 + -8 = -4

1. _____

2. _____

3. _____

4. _____

5. _____

6. _____

7. _____

8. _____

9. _____

10. _____

11. _____

12. _____

LIVEWORKSHEETS