GREENFIELD SCHOOL

Cambridge Assessment International Education

Cambridge International School

Happy School : an education from the heart within

Cambridge Primary Programme

CAMBRIDGE PRIMARY MATHEMATICS 1

REVISION 4

Name: _____ Date: _____ Class: _____

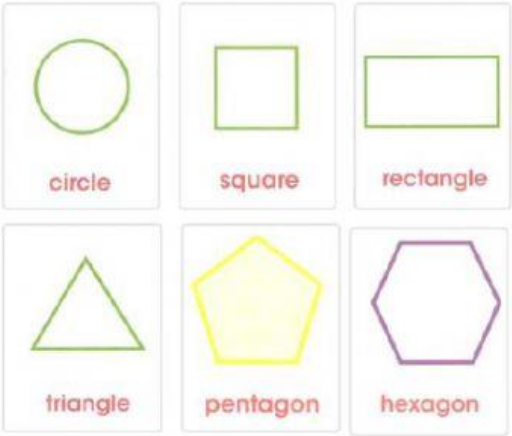

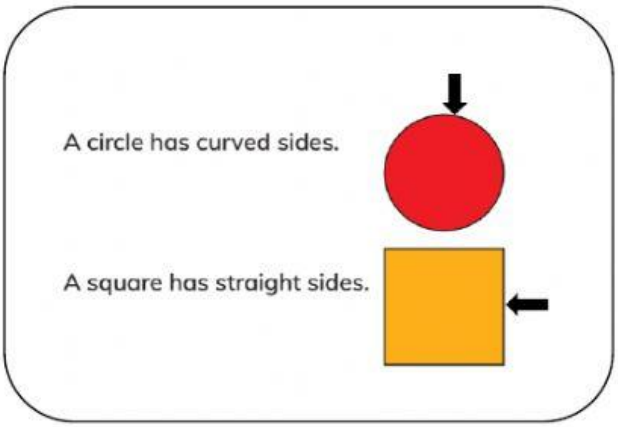

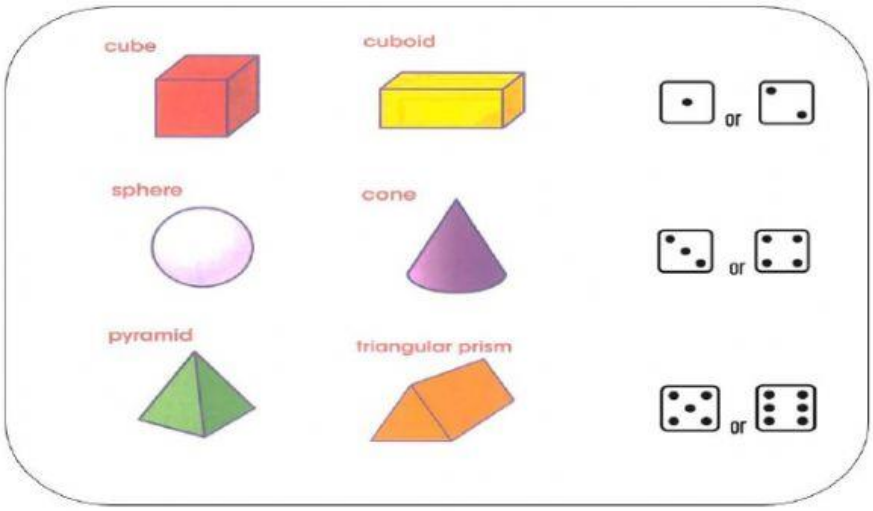

LIVEWORKSHEETS

1. Tick the shapes that match their names.

Name	Shapes		
1. rectangle			
2. triangle			
3. square	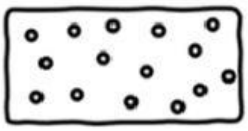		
4. hexagon			
5. pentagon			

LIVEWORKSHEETS

2. Draw lines to match the shape names and shapes.

a cone

b cube

c pyramid

d triangular prism

e cuboid

f sphere

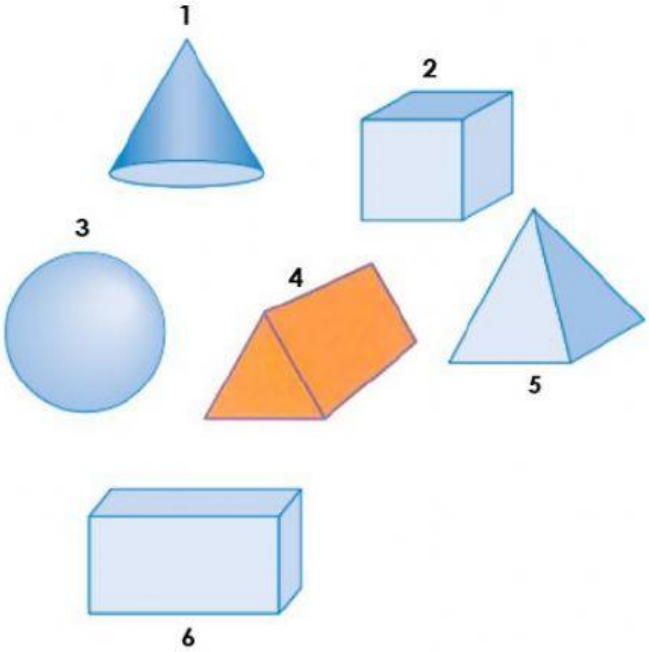

3. Count and write.

How many triangles? ☐

How many squares? ☐

How many rectangles? ☐

How many circles? ☐

How many pentagons? ☐

How many hexagons? ☐

LIVEWORKSHEETS

4. Choose the object that matches the first shape.

1.

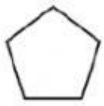

2.

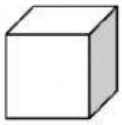

3.

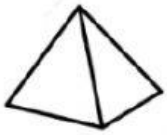

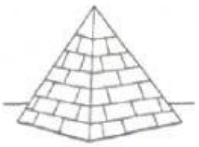

4.

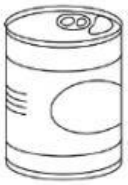

5.

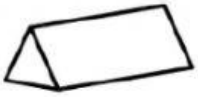

LIVEWORKSHEETS

5. What 3D shapes can you make by putting these 2D shapes together? Look and match.

a





cuboid

b

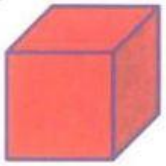

cube

c



triangular prism

d



pyramid

LIVEWORKSHEETS