- Collega con una linea ogni poligono alla giusta formula per il calcolo del suo perimetro.

$P = \ell \times 4$

$P = \ell_1 + \ell_2 + \ell_3$

$P = (b + h) \times 2$

$P = \ell \times 5$

$P = \ell_1 + \ell_2 + \ell_3 + \ell_4$

$P = (\ell \times 2) + b$

$P = \ell \times 3$

$P = B + b + \ell_1 + \ell_2$

$P = \ell \times 6$

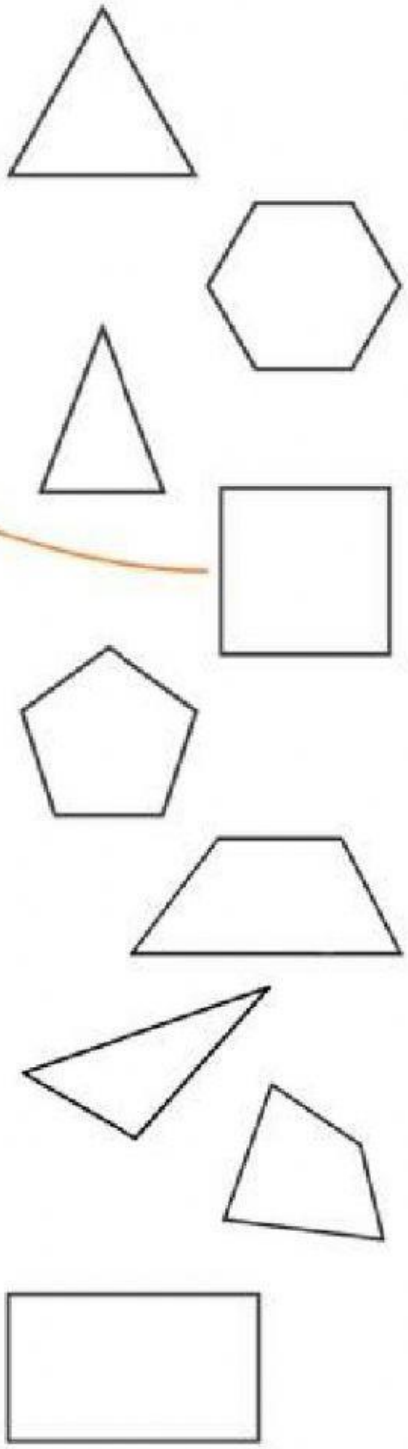

LIVEWORKSHEETS

- Calcola i perimetri dei seguenti poligoni regolari utilizzando le misure che vedi indicate.

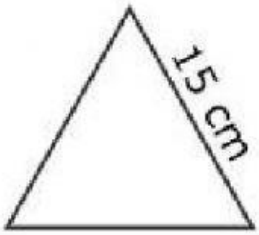

P = ...



P = ...

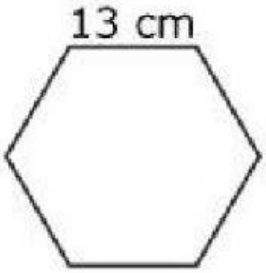

P = ...

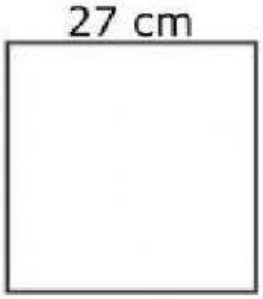

P = ...

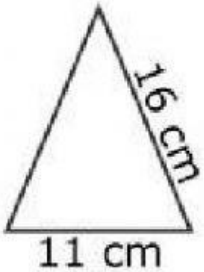

P = ...

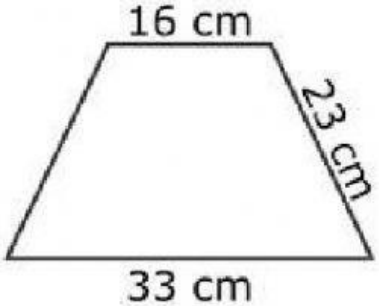

P = ...

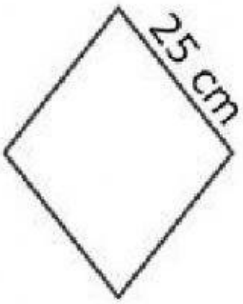

P = ...

P = ...

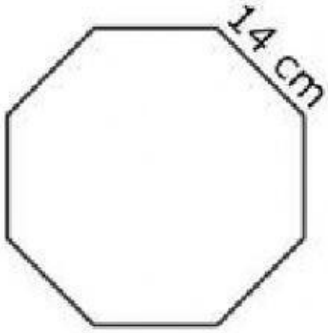

P = ...

LIVEWORKSHEETS