Activitat_Romànic & Gòtic

1. Identifica amb el nom els següents elements arquitectònics.

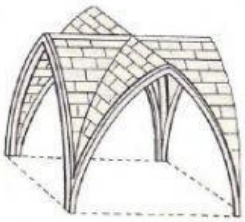

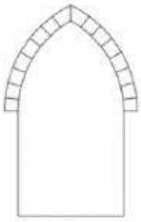






2. Observa la secció d'aquest edifici. Identifica cada element arquitectònic amb el numero que li correspon.

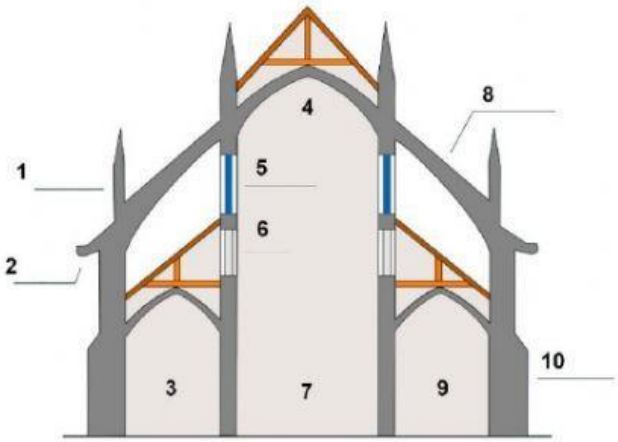

	Arcbotant
	Contrafort
	Nau central
	Claristori
	Nau lateral

	Pinacle
	Trifori
	Arc ogival
	Nau lateral
	Gàrgola

3. Identifica cada un dels elements arquitectònics d'aquesta portalada.



a.

b.

c.

d.

e.

Brancal
Arquivoltes
Timpà
Llinda
Mainell

LIVEWORKSHEETS