Name: _____

Match the fraction to the pictures.

1 Whole	½	1/3	¼	1/5

_____



_____

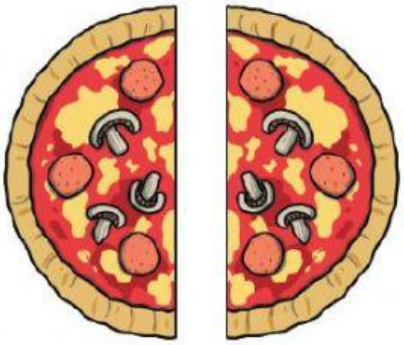

_____

_____

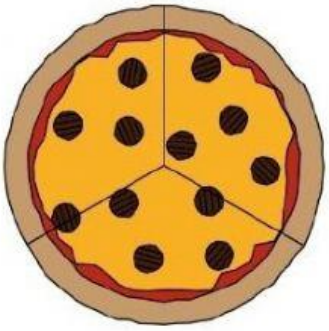

_____

LIVEWORKSHEETS