MATH REVISION

Multiplication and Division Grade 1

Solve these questions

1.



3 + 3 + 3 + 3 + 3 = _____

3 x 5 = _____

5 x 3 = _____

2. Each boy has 2 balls. How many balls altogether?



2 + 2 + 2 + 2 + 2 + 2 + 2 + 2= _____

2 x 8 = _____

8 x 2 = _____

3. How many meatballs altogether?

2 + 2 + 2 + 2 + 2 + 2 + 2= _____

2 x 7 = _____

7 x 2 = _____

LIVEWORKSHEETS

4. Feed these 18 flies to 3 frogs equally.



18 - ____ - _____ - _____ = 0

18 ÷ 3 = _____

18 ÷ 6 = _____

5. Put these 21 strawberries to 3 cakes equally.



21 - ____ - _____ - _____ = 0

21 ÷ 3 = _____

21 ÷ 7 = _____

LIVEWORKSHEETS