Poliedros. Volúmenes y áreas laterales

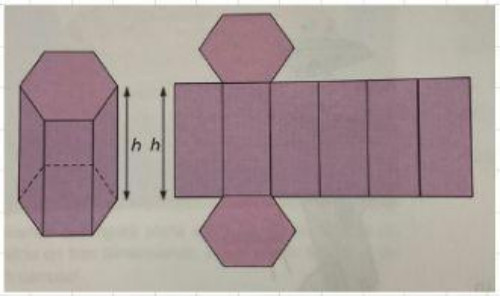

Datos
$h = 15$ cm
$\ell = 5$ cm

$A_L =$ cm^2

$V =$ cm^3

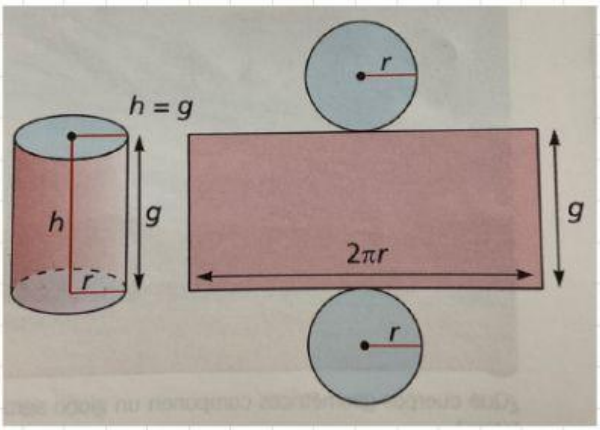

Datos
$h = 15$cm
$r = 5$cm

$A_L =$ cm^2

$V =$ cm^3

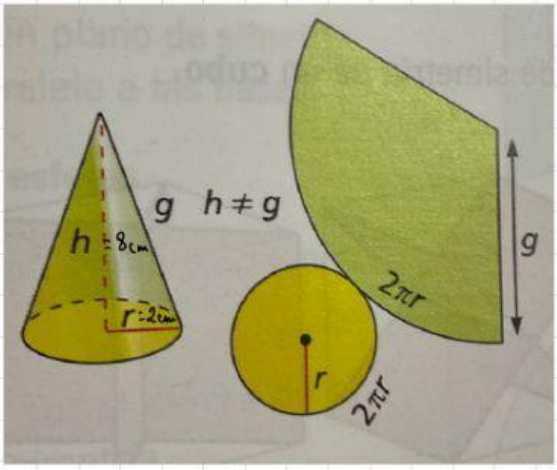

Datos
$h = 8$cm
$r = 2$cm

$A_L =$ cm^2

$V =$ cm^3

LIVEWORKSHEETS