Codeyoung

Recap of numbers 1 to 100

Grade 2

Q1-

Fill in the missing numbers on each number line below.

a

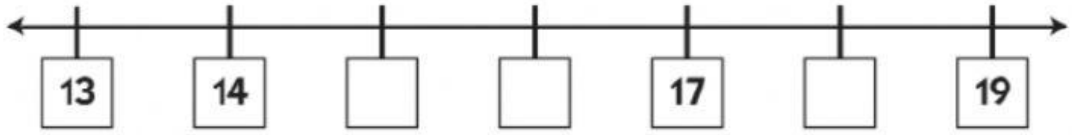

b

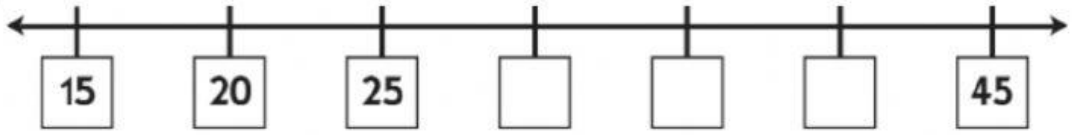

c

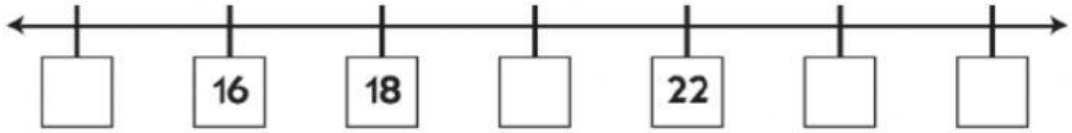

d

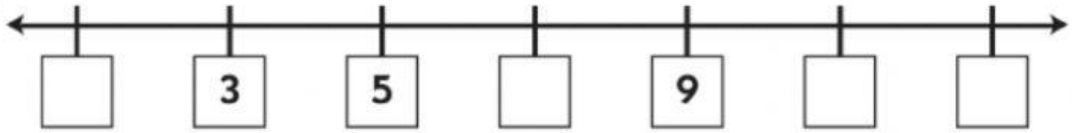

e

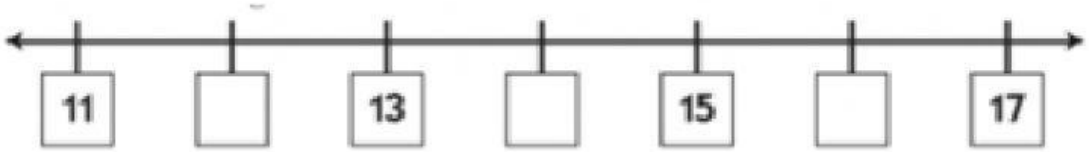

f

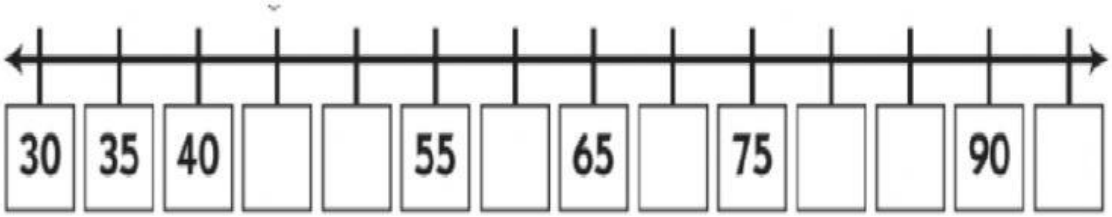

LIVEWORKSHEETS

2 The numbers in the box are mixed up! Put them in order from least to greatest.

62 51 17 78 40 14

_____, _____, _____, _____, _____, _____

least greatest

Q3-

Fill in the missing numbers to solve these equations. Use the pictures to help.

a _____ = 5 + 5 	**b** 10 = 2 + 4 + _____ 
c 10 = _____ + 2 	**d** 7 + _____ = 10 

Q4-

15	14	13	10	14	14	19
- 2	- 6	- 3	- 2	- 7	- 8	- 9
____	____	____	____	____	____	____

LIVEWORKSHEETS