I. Operation

A. Multiplication

(a) 122 x 2 = ☐

(b) 100 x 4 = ☐

(c) 313 x 3 = ☐

(d) 212 x 4 = ☐

(e) 230 x 2 = ☐

(f) 120 x 4 = ☐

B. Division



20 ÷ 5 = ☐	18 ÷ 6 = ☐
12 ÷ 4 = ☐	36 ÷ 9 = ☐
3 ÷ 1 = ☐	9 ÷ 3 = ☐
16 ÷ 2 = ☐	48 ÷ 6 = ☐
14 ÷ 7 = ☐	10 ÷ 2 = ☐

LIVEWORKSHEETS

C. Relationship between multiplication and division.

1)

_____ x _____ = _____ _____ ÷ _____ = _____

2)

_____ x _____ = _____ _____ ÷ _____ = _____

3)

_____ x _____ = _____ _____ ÷ _____ = _____

D. Word Problem (solve in a piece of paper and write your answer on the blank)

1. Mary bought 7 boxes of doughnuts. Each box has half a dozen of doughnut. She eat 2 pieces on her way home. How many pieces will she be able to bring home?

   Mary brings home [ ] doughnuts.

2. If the hair clip costs 6pesos each and Amy bought 8 pieces of them, how much will she pay for all of the hair clips?

   Amy will pay [ ] pesos for the 8 hair clips.

3. Tim collected 72 pieces of quail eggs. He wanted to share them equally among his 7 close friends. How many quail eggs will each friend receive? How many extra quail eggs will there be?

   Each friend will get [ ] eggs. There will be [ ] extra eggs.

LIVEWORKSHEETS

II. Fraction

A. Identify the fraction

Figure	Fraction of the shaded part	Fraction of the unshaded part
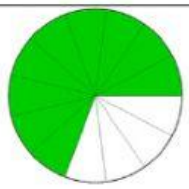		

B. Arrange the following unit fractions from least to greatest.

$\frac{1}{2}$ $\frac{1}{9}$ $\frac{1}{4}$ $\frac{1}{3}$ $\frac{1}{7}$

Least number here				

C. Arrange from the similar fractions from greatest to least.

$\frac{8}{9}$, $\frac{3}{9}$, $\frac{1}{9}$, $\frac{9}{9}$, $\frac{7}{9}$

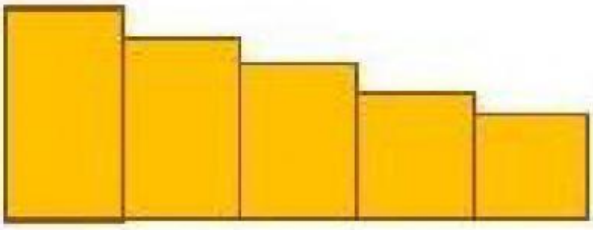

D. Compare the fractions

$\frac{2}{8}$ _____ $\frac{2}{2}$ $\frac{6}{12}$ _____ $\frac{2}{12}$ $\frac{1}{6}$ _____ $\frac{2}{6}$

LIVEWORKSHEETS

III. Geometry

A. Put a check on the objects that are symmetrical.

B. Tessellation

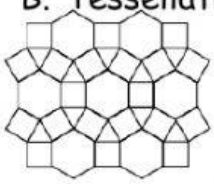

Identify the shapes you can find in the pattern? Write yes or no

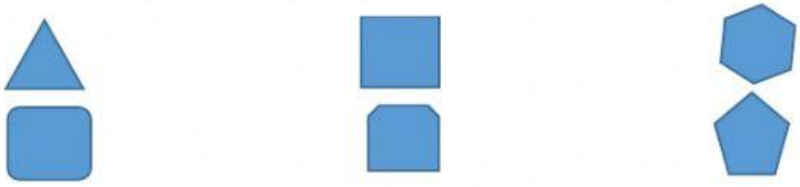

C. Geometry

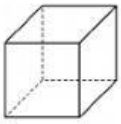

____faces _____edges _____corners _____curved surface

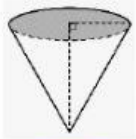

____ faces _____ edges _____ corners _____ curved surface

____ faces _____ edges _____ corners _____ curved surface

LIVEWORKSHEETS