Codeyoung

Grade 2

Addition

Concept check worksheet

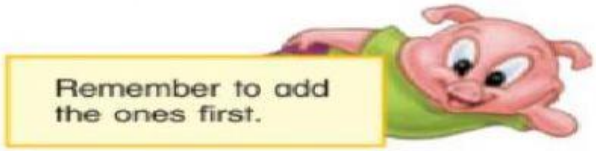

Q1-

Fill in the missing numbers to complete the addition facts.

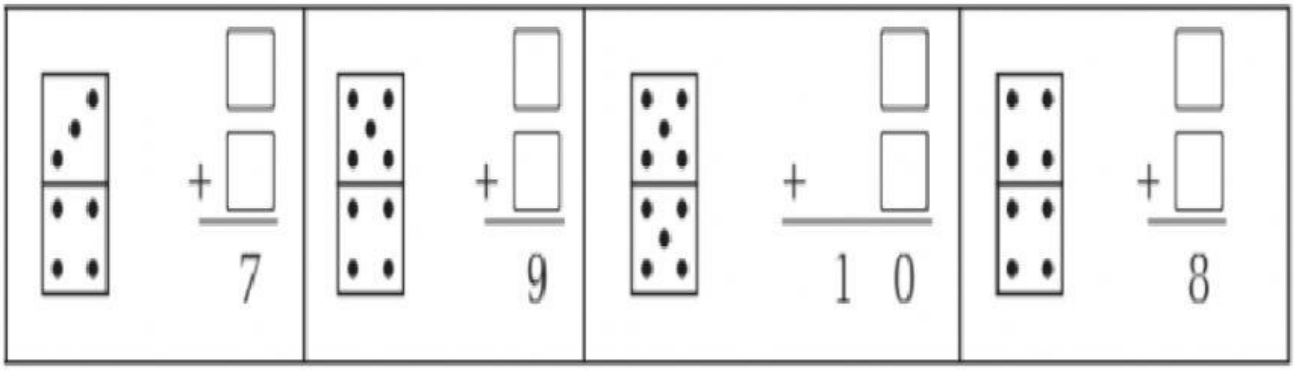

Q2-

Write an equation to match each cube train.

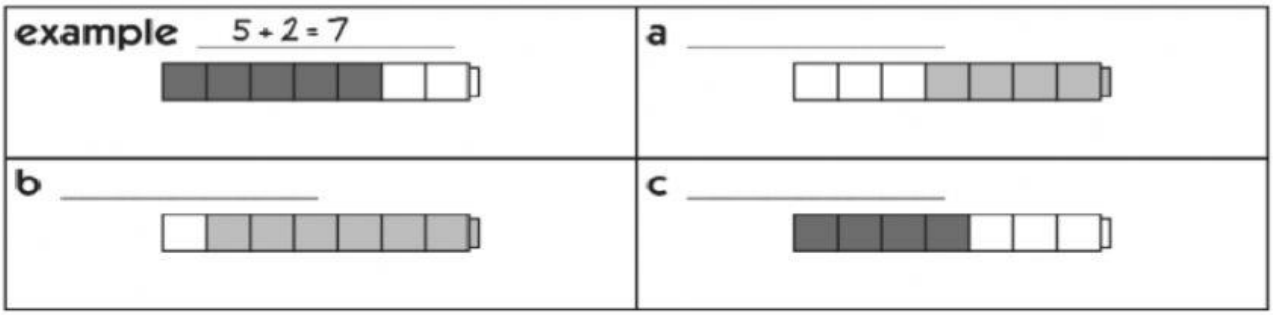

LIVEWORKSHEETS

Q3-Add

1.

	tens	ones
	3	1
+	1	8
	4	9

2.

	tens	ones
	1	2
+	6	5

3.

	tens	ones
	1	5
+	2	3

4.

	tens	ones
	2	1
+	3	4

5. $22 + 62$

6. $48 + 30$

7. $60 + 17$

8. $36 + 52$

9. $42 + 57$

10. $35 + 31$

11. $15 + 52$

12. $76 + 13$

13. $45 + 44$

14. $70 + 29$

LIVEWORKSHEETS