Grade 1 Music Theory Review Worksheet

1. How many A notes are there in this tune?_____



A 2 **B** 3 **C** 4 **D** 5

2. Which of these terms mean 'in a singing style'?_____

A andante **B** cantible **C** allegretto **D** crescendo

3. How many minims are there in this tune?_____



A 2 **B** 3 **C** 4 **D** 1

4. How many beats/counts is this rest worth?_____

A 2 **B** 3 **C** 4 **D** 5

5. Which tune is in 'G major'?_____

a. 

b. 

LIVEWORKSHEETS

c. 

d. 

6. What is the name of this note? _____

A A sharp **B** A double flat **C** A natural **D** A flat

7. If you want the music to get gradually quieter you use..._____

A

B

C

D >

8. How long is this tied note? _____

A 1 beat **B** 6 beats **C** 3 beats **D** 4 beats

9. This time signature means_____

A 3 quavers in a bar **B** 3 semibreves in a bar

C 3 semiquavers in a bar **D** 3 crotchets in a bar

LIVEWORKSHEETS

10. Which of these bars show a **tone**?_____

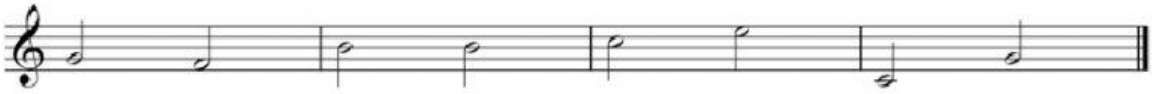

A Bar 1 **B** Bar 2 **C** Bar 3 **D** Bar 4

11. What is the name of this note  in the treble clef?_____

A note G **B** note D **C** note B **D** note C

12. What is the interval between these two notes?_____ 

A 5th **B** 6th **C** 7th **D** 8ve

LIVEWORKSHEETS