Identify the denominator of each fraction.

1

1

1

2

1

3

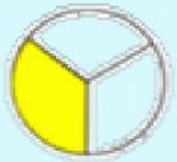

1

4

What fraction of the squares are white?



4

What fraction of the arrows point up?

4

What fraction of the triangles are green?



8

What fraction of the stars are white?

2