Name -			
Phase 1– Foundation Numeracy **Class Worksheet -20**			
Stage-	Progressing	Grade-	2
Conceptual Area -	Geometry	Topic-	Spacial understanding of 2 D shapes

A. Mark the side and corner

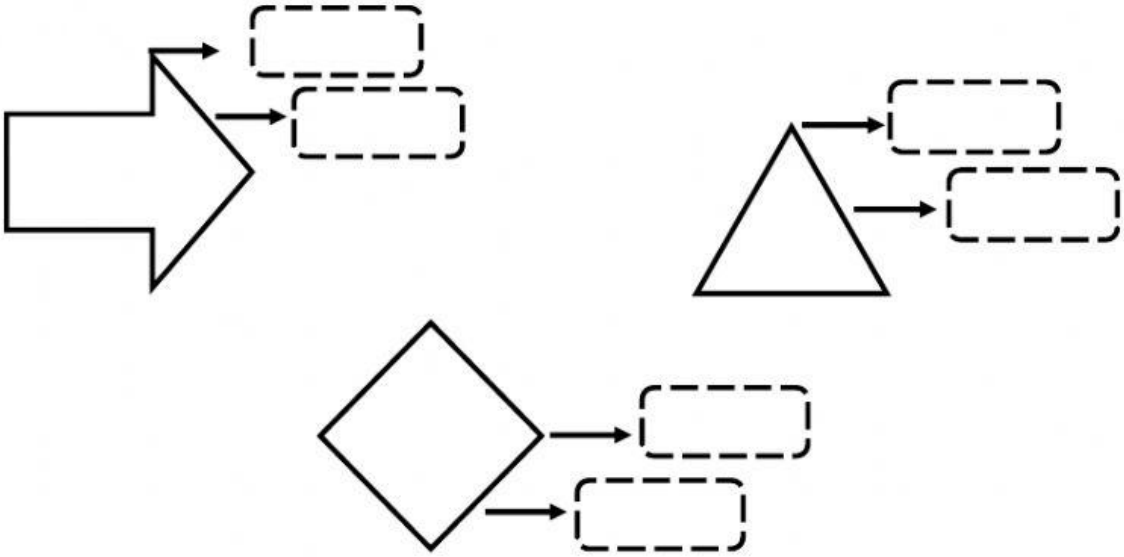

B. Colour shapes that have 4 sides

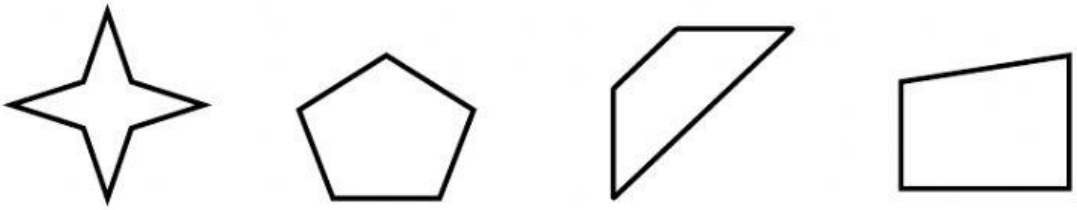

C. Colour shapes that have 4 sides



LIVEWORKSHEETS

LEARNING LINKS FOUNDATION

WORKSHEET

D. Colour the shapes that have curved sides

E. Write the number of sides and corners in each shape.

- Number of sides ____
- Number of corners ____

- Number of sides ____
- Number of corners ____

- Number of sides ____
- Number of corners ____



- Number of sides ____
- Number of corners ____

- Number of sides ____
- Number of corners ____

- Number of sides ____
- Number of corners ____

 ©Learning Links Foundation

LIVEWORKSHEETS