Name -			
Phase 1– Foundation Numeracy **Class Worksheet -14**			
Stage-	Progressing	Grade-	2
Conceptual Area -	Measurement	Topic-	Comparing and measuring mass

A. Put a cross × on the heavier object.

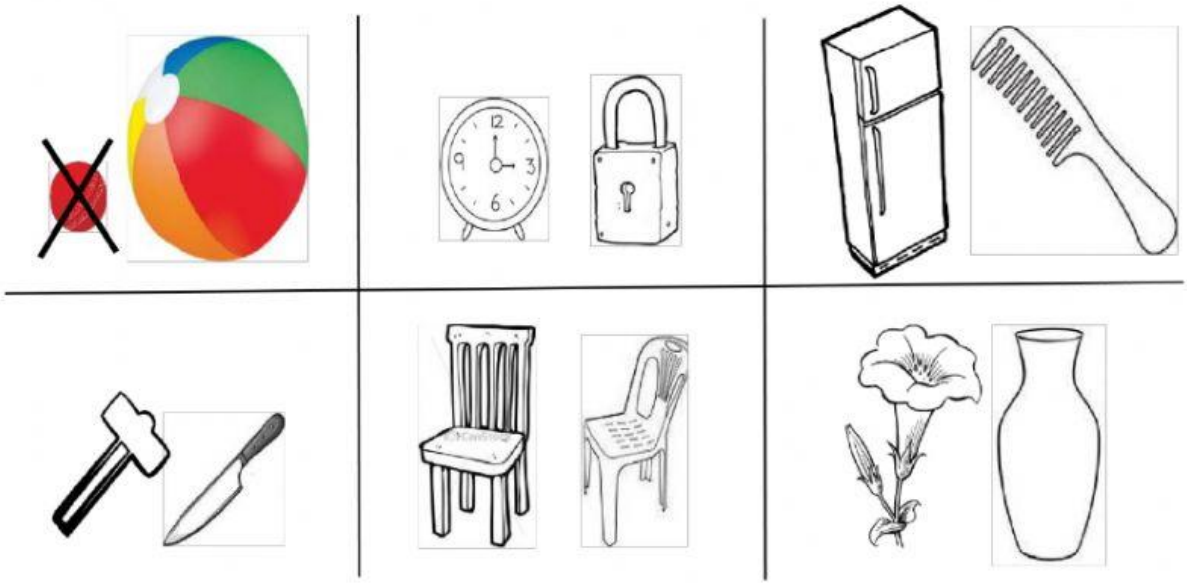

B. Where will you keep the two objects on the balance

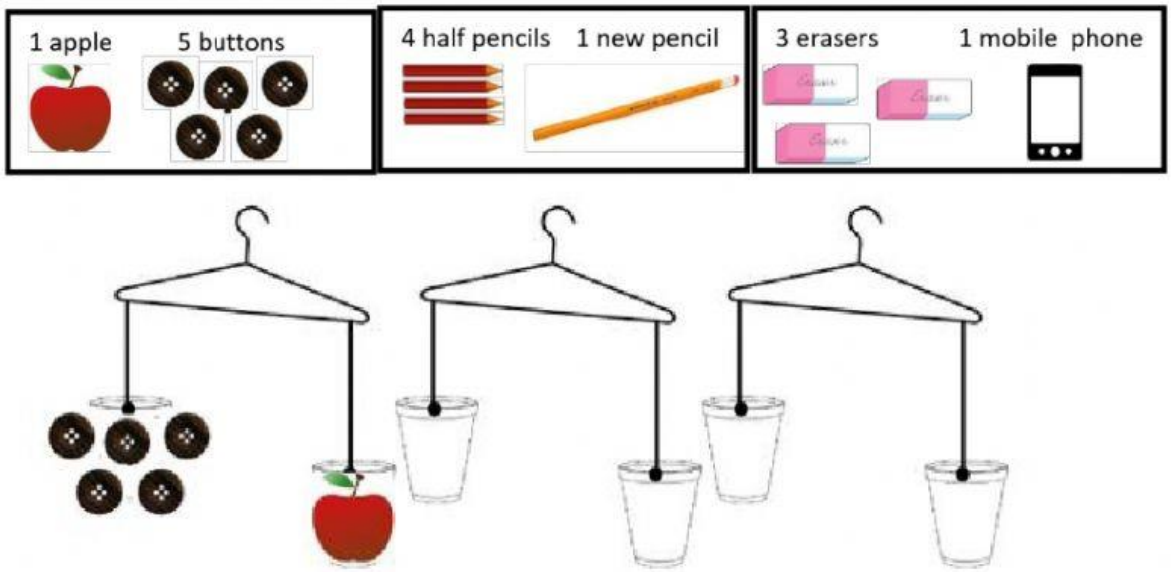

LIVEWORKSHEETS

LEARNING LINKS FOUNDATION

WORKSHEET

C. Put the objects according to their weight on the see-saw.



D. Fill in the blanks choosing from the given words and looking at the pictures above

a. _____ is heavier than _____. (toffee / apple)

b. _____ is heavier than_____. (kettle / cup)

c. _____ is lighter than _____ . (crayons/ pencil)

d. _____ is lighter than _____. (leaf / mango)

 ©Learning Links Foundation

LIVEWORKSHEETS