Vertical Addition

Add all the flowers. How many are there in all?

3
+4
_____



2
+2
_____



5
+4
_____



6
+1
_____



LIVEWORKSHEETS