Activity

Level 1: **Multiple choice:**

1- Which of these pictures represents a polygon shape:

a.  **b.**  **c.** 

2- Which of these pictures represents a non- polygon shape:

a. 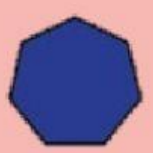 **b.**  **c.** 

3- Which of the following options represents a pentagon?

a.  **b.**  **c.** 

Level 2: **Match each polygon with its correct description:**

1- I have 3 sides and 3 angles.	
2- I am an incomplete shape, I have 4 sides and 3 angles.	
3- I have 8 sides and 8 angles.	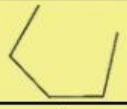
	

Level 3: **look around the classroom and write at least three shapes that are polygon and non-polygon, and describe it in terms of the sides and angles.**

Polygon shapes	Non-polygon shapes

LIVEWORKSHEETS