ÁREA DE POLÍGONOS

Halla el área de los siguientes polígonos y arrastra la respectiva respuesta debajo del polígono correspondiente.

36 Cm^2 16 Cm^2 24 Cm^2

8 Cm^2 32 Cm^2

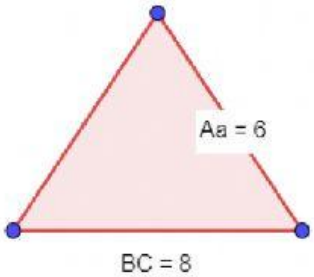

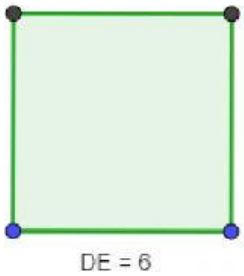

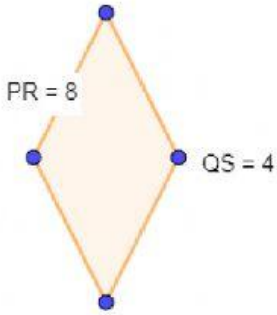

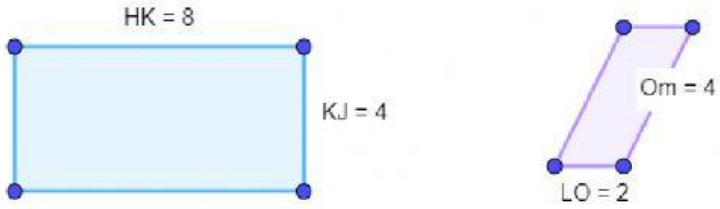
HK = 8
KJ = 4
Om = 4
LO = 2