Name : _____ Date: _____

# DIVISION PROBLEM

1) How many groups of 3 are there? _____ 12 ÷ 3 = _____

2) How many groups of 4 are there? _____ 8 ÷ 4 = _____



3) How many groups of 2 are there? _____ _____ ÷ 2 = _____



4) How many groups of 5 are there? _____ _____ ÷ 5 = _____

5) How many groups of 10 are there? _____ ÷ 10 = _____



6) How many groups of 3 are there? _____ _____ ÷ 3 = _____

LIVEWORKSHEETS