MUNDO INFANTIL SCHOOL

1ST PARTIAL 35% **SOCIAL STUDIES TEST** **Mrs. Michell Rosa**

I. Write the word that corresponds to the image.

1. Lines of:

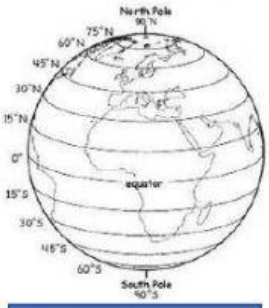

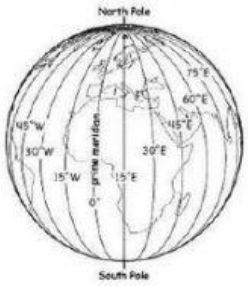

2. Type of map projection:

3. Parts of a map:

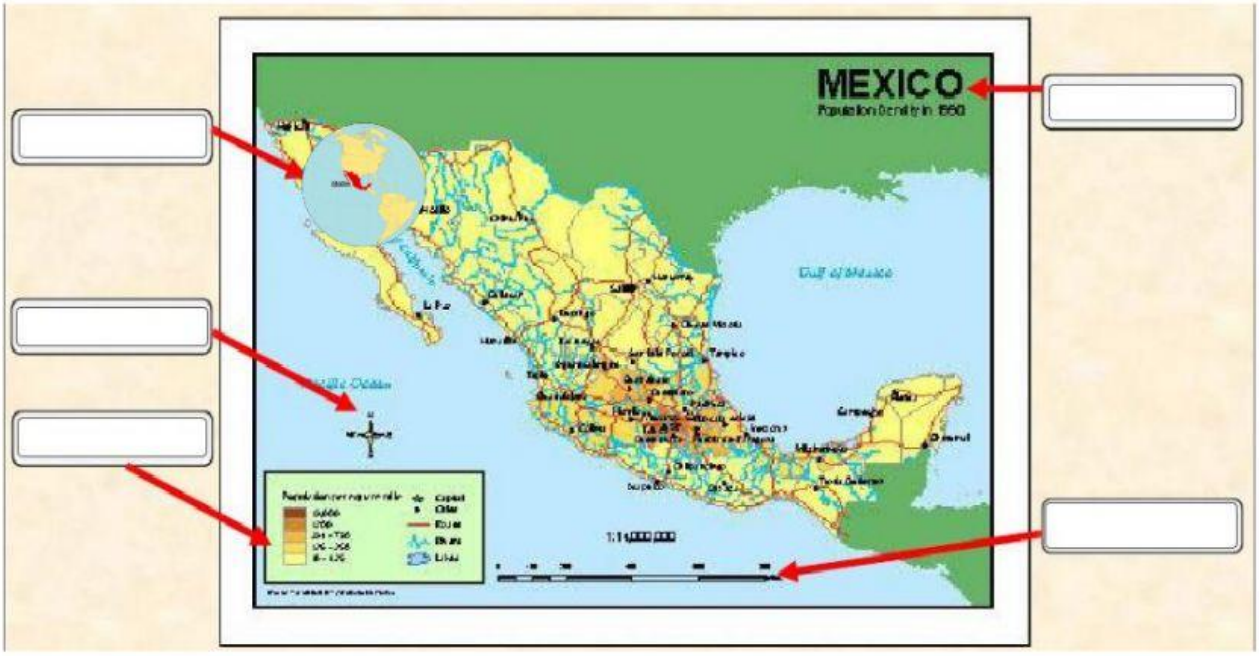

LIVEWORKSHEETS

II. Write if its Relative or Absolute location.

1. **The bakery store is located at 110` 32 west and 23`2 north. _____**
2. **The movie theater is between the Chinese restaurant and the bakery. _____**

III. Write the word from the box that corresponds to each definition.

Culture – cultural trait – norm – cultural region – cultural landscape – society – family – nuclear family – extended family – science – social structure – social class – language – religion – ethics – irrigate - diversity- cultural hearth – cultural diffusion – standard of living

1. **_____ supply water to crops**
2. **_____ pattern of organized relationships among groups of people within a society.**
3. **_____ is an idea or way of doing things that is common in a certain culture.**
4. **_____ is a family that consists of parents and their children**
5. **_____ standards of acceptable behavior.**
6. **_____ spread of cultural traits from one culture to another**

LIVEWORKSHEETS