Name:_____ **Fractions** Class:_____

A) Compare the fractions with < > =.

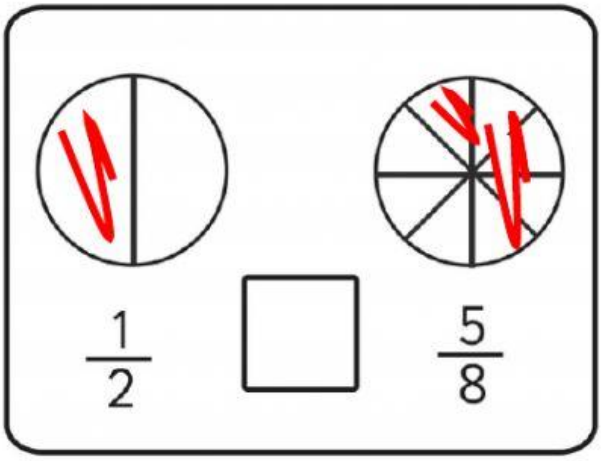

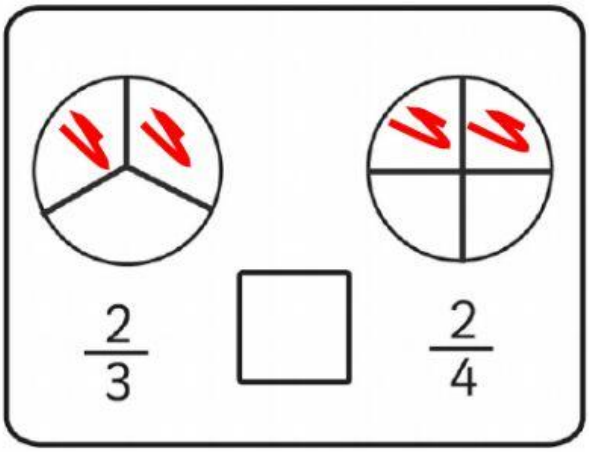

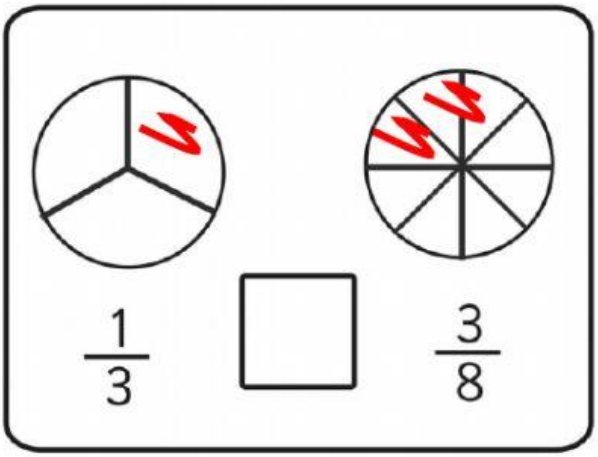

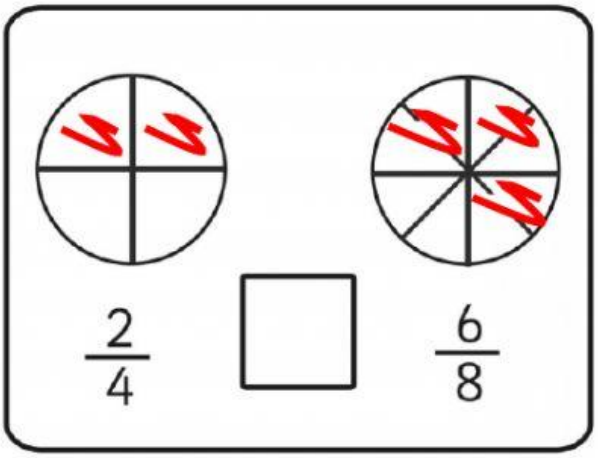

B) Solve the fraction word problems and explain.

A boy reads $\frac{2}{3}$ of a book and a girl reads $\frac{1}{3}$ of a book.

Who reads more?

Word Answer and explanation:

_____

_____

LIVEWORKSHEETS

Sam walks $\frac{4}{6}$ of a road. Tom walks $\frac{5}{6}$ of a road.

Who walks more of the road?

Word Answer and explanation:

_____

_____

Lee eats $\frac{3}{4}$ of a cake. Mai eats $\frac{7}{8}$ of a cake.

Who eats more cake?

Word Answer and explanation:

_____

_____

Tim eats $\frac{1}{3}$ of a burger. Kim eats $\frac{2}{4}$ of a burger.

Who eats more burger?

Word Answer and explanation:

_____

_____

LIVEWORKSHEETS