	Angles 3	**ESO1**
	Nom i cognoms:	

Digues el tipus d'angles que formen A, B, C, D, F, E, G i H entre ells, segons indica la taula:

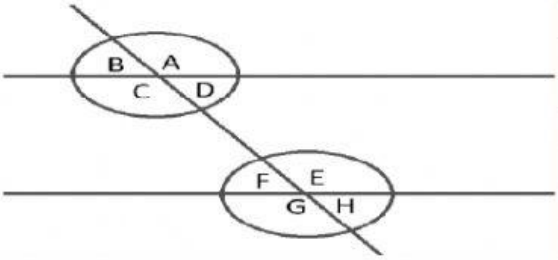

$< F = < H$	
$< B = < F$	
$< D + < E = 180^0$	
$< D = < F$	
$< A = < C$	
$< C = < G$	
$< B = < D$	
$< B + < G = 180^0$	
$< C = < E$	
$< D = < H$	
$< E = < G$	
$< C + < F = 180^0$	
$< A = < E$	
$< A + < H = 180^0$	

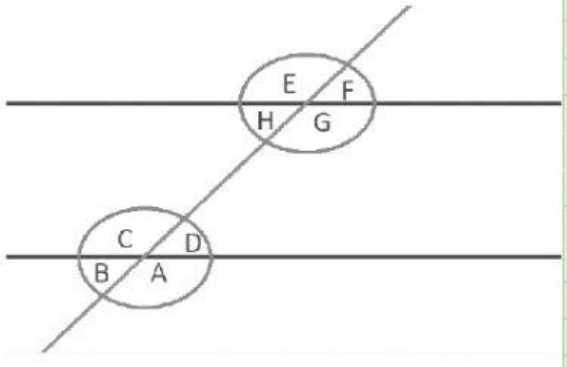

$< D = < B$	
$< E = < C$	
$< H + < C = 180^0$	
$< F = < H$	
$< H = < B$	
$< C = < G$	
$< E = < A$	
$< E + < B = 180^0$	
$< F = < B$	
$< G = < A$	
$< G = < C$	
$< F + < A = 180^0$	
$< E = < G$	
$< G + < D = 180^0$	

Angles oposats pel vèrtex	*Angles corresponents*	*Angles colaterals interns*	*Angles alterns interns.*
$< 1 = < 3$	$< 1 = < 5$	$< 4 + < 5 = 180^0$	$< 3 = < 5$
$< 2 = < 4$	$< 2 = < 6$	$< 3 + < 6 = 180^0$	$< 4 = < 6$
$< 5 = < 7$	$< 3 = < 7$	*Angles colaterals externs.*	*Angles alterns externs.*
$< 6 = < 8$	$< 4 = < 8$	$< 1 + < 8 = 180^0$	$< 1 = < 7$
		$< 2 + < 7 = 180^0$	$< 2 = < 8$

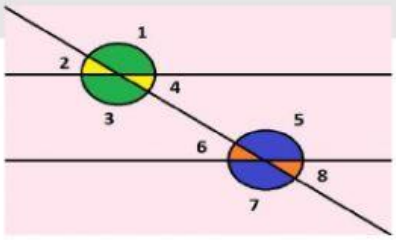

LIVEWORKSHEETS