BÀI 9 - PHIẾU BÀI TẬP SỐ 1

Viết các phân số biểu diễn phần được tô màu tương ứng:

$\frac{1}{2}$	 —	—
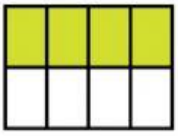 —	—	 —
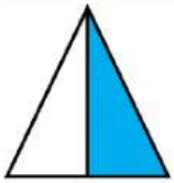 —	—	—
—	—	 —
 —	 —	 —

LIVEWORKSHEETS