Practice 2 Multiplication of a Mixed Number by a Whole Number

1. Study the picture. Then, fill in the blanks.

(a)

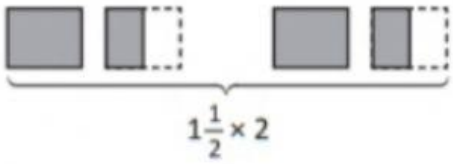

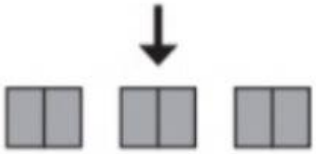

$1\frac{1}{2} \times 2 = \frac{\square}{\square} \times \square$

$= \square$

(b)

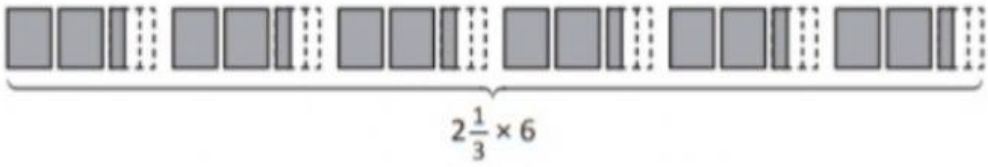

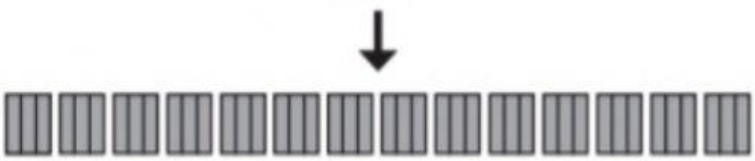

$2\frac{1}{3} \times 6 = \frac{\square}{\square} \times \square$

$= \square$

LIVEWORKSHEETS