Laboratorio di geometria.

c.d.2020

Definisci i triangoli in base ai lati

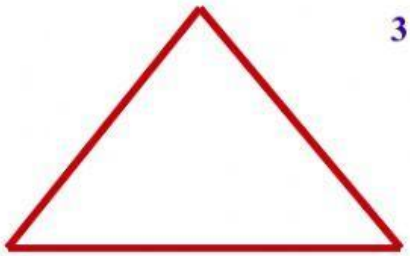

3 lati congruenti



2 lati congruenti



3 lati non congruenti