JG INTERNATIONAL SCHOOL

a class apart...

Q1. Write the fraction of the shaded part below each for the following:

4/8 Four eighths	
	
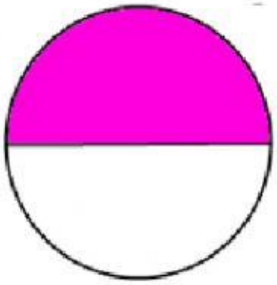	

½ **Half**	**3/6 Three sixths**	⅓ **One third**	4/5 **Four fifths**	5/6 **Five sixths**

LIVEWORKSHEETS

Q2. Write down the fraction that shows what part of each set is coloured.

 $\frac{2}{4}$ $\frac{4}{4}$	 $\frac{2}{5}$ $\frac{3}{5}$
 $\frac{5}{6}$ $\frac{1}{6}$	 $\frac{4}{7}$ $\frac{3}{7}$

LIVEWORKSHEETS