Name: _____ Date: _____

POLYHEDRON

Scavenger Hunt Activity

Directions: Find two real-world examples for each shape from your classroom, school, or home. How many faces, vertices, and edges does each shape have?

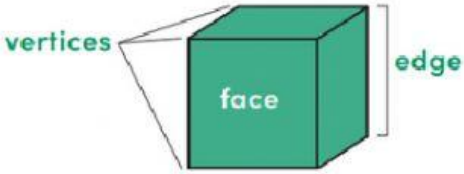

3D Shape	Real-World Example #1	Real-World Example #2	Attributes (What does it look like?)
cube 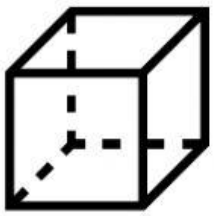			_____ faces _____ vertices _____ edges
cuboid 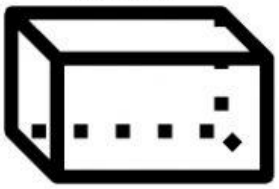			_____ faces _____ vertices _____ edges
triangular prism 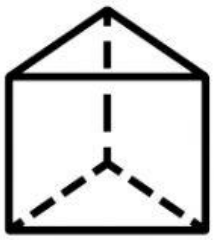			_____ faces _____ vertices _____ edges
square-based pyramid 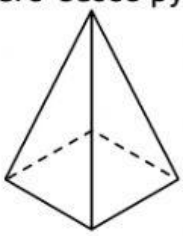			_____ faces _____ vertices _____ edges

LIVEWORKSHEETS