Name _____ Date _____

Check My Progress *(Lessons 1 through 3)*

Name the polygon. Determine if it appears to be *regular* or *not regular*.

1.

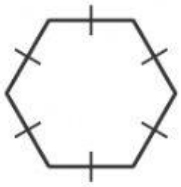

1. _____

_____

2.



2. _____

_____

Determine the number of congruent sides. Then classify the triangle based on its sides.

3.

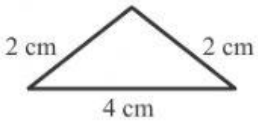

3. _____

4.

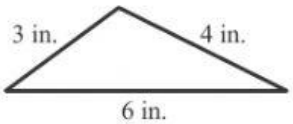

4. _____

Classify the triangle based on its angles.

5.

5. _____

6.

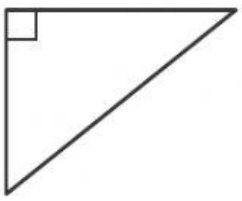

6. _____

LIVEWORKSHEETS