Nama : Kelas :

BENTUK 3 DIMENSI

1. Tulis nama setiap bentuk.
2. Kira dan tulis bilangan permukaan rata, permukaan melengkung, sisi dan bucu.

BENTUK	NAMA	BILANGAN			
		PERMUKAAN		SISI	BUCU
		RATA	MELENGKUNG		
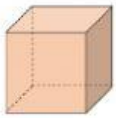					
					
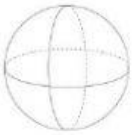					

LIVEWORKSHEETS