Math Class Practice

III Quarter

1. Look at the picture and write the amount of money:

a.

b.

c.

d.

e.

LIVEWORKSHEETS

2. Look at the pictures and label them correctly.

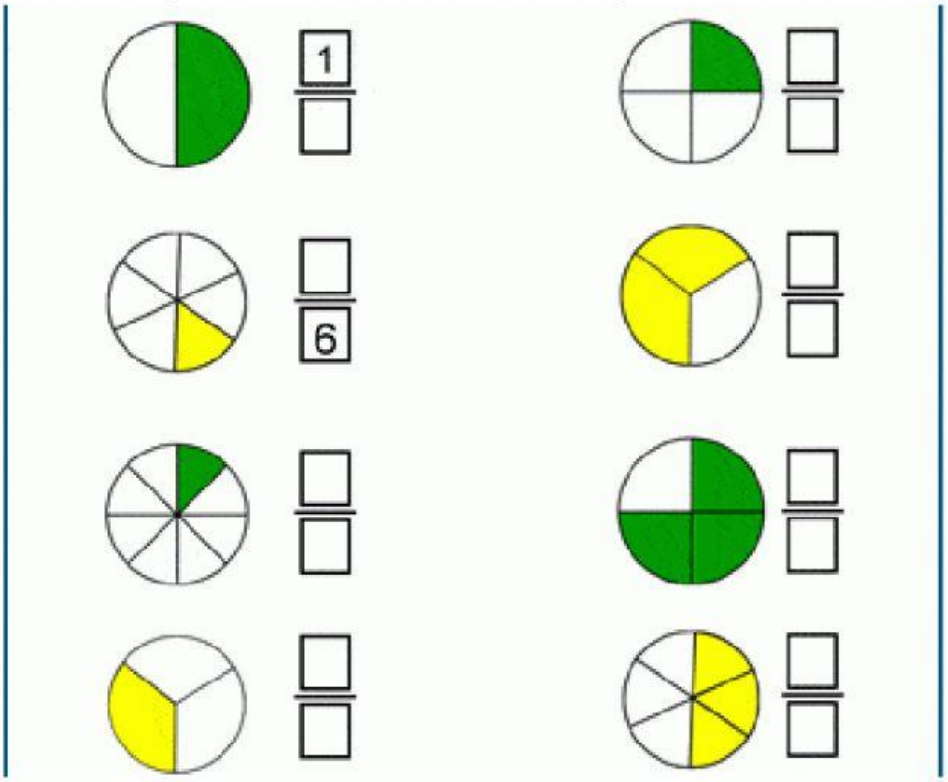

3. Write the fractions for shaded parts.

1.

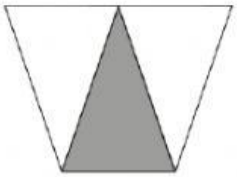

_____

2.

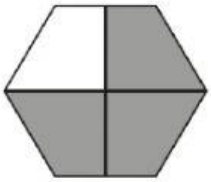

_____

3.

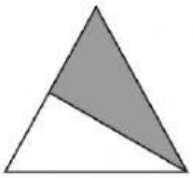

_____

LIVEWORKSHEETS

4. Match the fractions correctly.

$\frac{1}{4}$ •

$\frac{1}{2}$ •

$\frac{2}{3}$ •

$\frac{1}{3}$ •

$\frac{3}{4}$ •

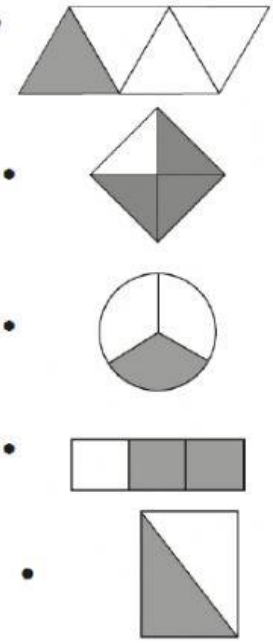

5. Chose the correct length for each object:

slide a. 3 inches b. 3 yards c. 3 centimeters	**toothbrush** a. 7 inches b. 15 inches c. 1 yard	**acorn** a. 2 centimeters b. 20 centimeters c. 200 centimeters
needle a. 14 inches b. 8 inches c. 2 inches	**pencil** a. 15 centimeters b. 15 inches c. 15 meters	**broom** a. 4 centimeters b. 4 meters c. 4 feet
comb a. 3 yards b. 6 inches c. 2 meters	**apple tree** a. 1 yard b. 10 yards c. 100 yards	**student** a. 6 yards b. 5 inches c. 4 feet

LIVEWORKSHEETS