Тук постави превозните средства, които се движат **наляво**

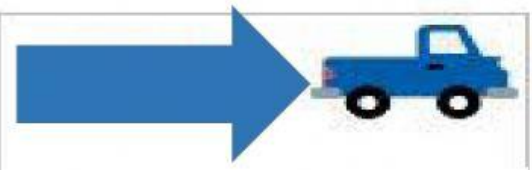

Тук постави превозните средства, които се движат **надясно**

Къде се намира мишлето спрямо другите предмети?