nizamia andalusia school

Name :	**Score :**
Class :	
Day and Date :	**Parent's Signature :**
Grade / Semester : 3 / Semester 2 **Week / Session : 12**	**Subject : Math** **Topic : Acute and Obtuse Angles**

Bismillahirrahmanirrahim

I. Match *the angles* with the *description*.

Right angle	More than 90 degrees
Acute angle	Less than 90 degrees
Obtuse angle	90 degrees
Angles on a straight line	180 degrees

II. Draw cross (x) in the box for the angle with wrong name.

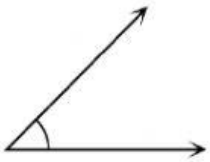

Acute angle ☐

Right angle ☐

LIVEWORKSHEETS

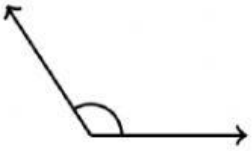

Obtuse angle ☐

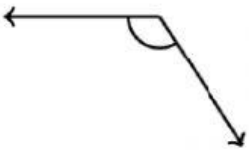

Right angle ☐

III. Look at the <u>minute hand</u> and <u>hour hand</u>.
Name the angles in between them.

a.

b.

c,

d.

Alhamdulillahirabbilalamin

LIVEWORKSHEETS