Stella's School

Rev 2022 Yr 6 06 - ANGLES

∟, ∠ IN A STRAIGHT LINE, ∠ AT A POINT AND VERT OPPS ∠

Name :_____ Class: _____ Date:_____

1) Calculate the missing angles below. [**ALL DIAGRAMS ARE NOT TO SCALE**]

a) Given that AB and BC are perpendicular

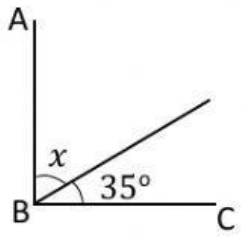

$\angle x =$ _____°

b) Given that AB and BC are perpendicular

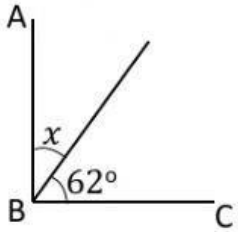

$\angle x =$ _____°

c) Given that AB and BC are perpendicular.

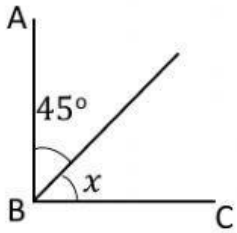

$\angle x =$ _____°

d) Given that AB and BC are perpendicular

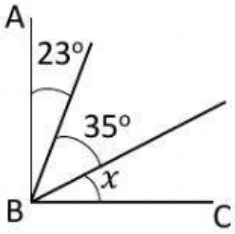

$\angle x =$ _____°

e) Given that AB is a straight line.

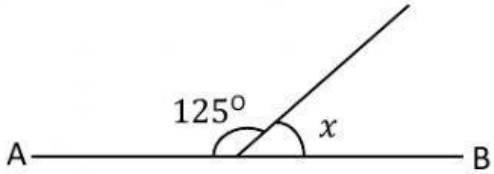

$\angle x =$ _____°

f) Given that AB is a straight line.

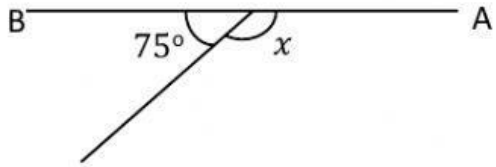

$\angle x =$ _____°

LIVEWORKSHEETS

g) Given that AB is a straight line.

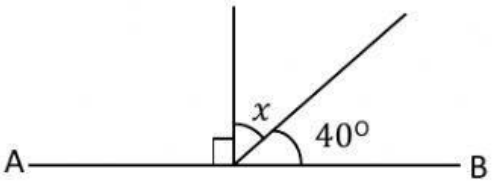

$\angle x =$ _____°

h) Given that AB is a straight line.

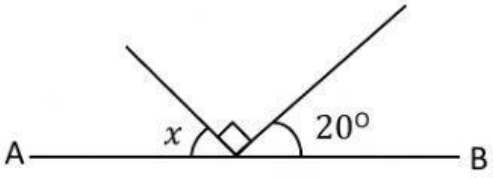

$\angle x =$ _____°

i)

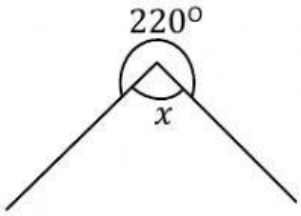

$\angle x =$ _____°

j)

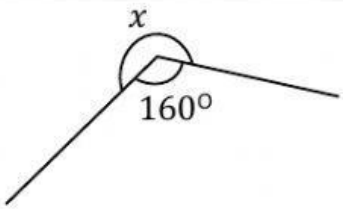

$\angle x =$ _____°

k)

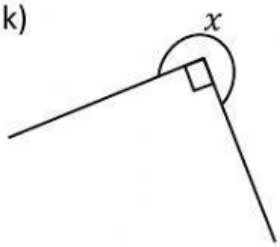

$\angle x =$ _____°

l)

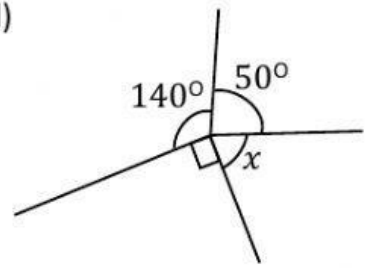

$\angle x =$ _____°

LIVEWORKSHEETS

m)

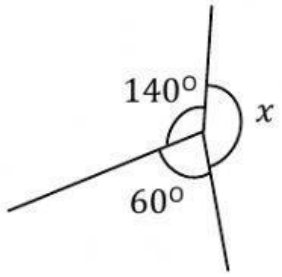

$\angle x =$ _____°

n) Given that AB and CD are two straight lines.

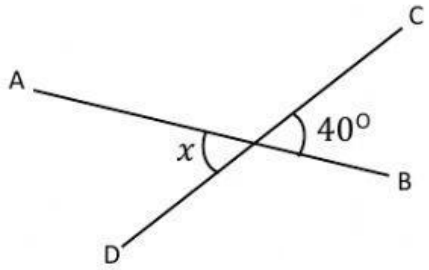

$\angle x =$ _____°

o) Given that AB and CD are two straight lines.

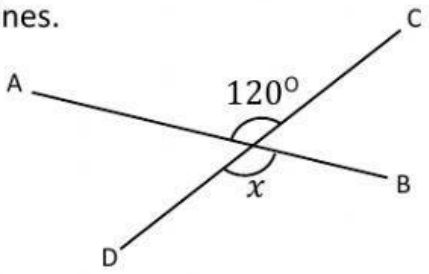

$\angle x =$ _____°

p) Given that AB and CD are two straight lines.

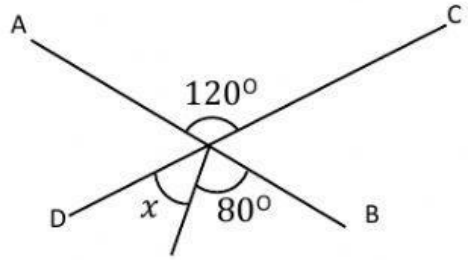

$\angle x =$ _____°

LIVEWORKSHEETS