Pangalan: _____

Pangkat: _____

MATHEMATICS 2
Worksheet #3

QUARTER 3

A. Panuto: Hanapin ang simbolong bilang para sa unit fraction. I-konek ito sa hanay B.

A

1.

2.

3.

4.

5. 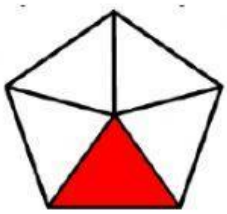

B.

a. $\frac{1}{4}$

b. $\frac{1}{8}$

c. $\frac{1}{2}$

d. $\frac{1}{5}$

e. $\frac{1}{7}$

LIVEWORKSHEETS

B. Panuto: Tukuyin kung alin sa mga sumusunod ang tamang pagsulat ng ngalan ng bawat unit fraction.

6.



7.

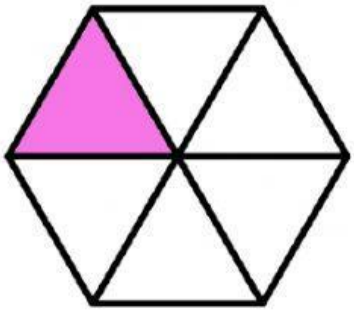

8.

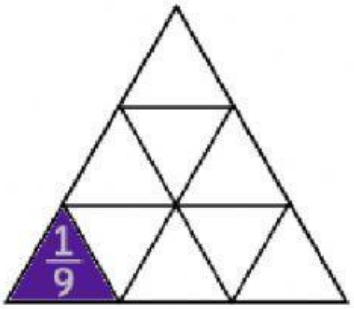

9.

10.

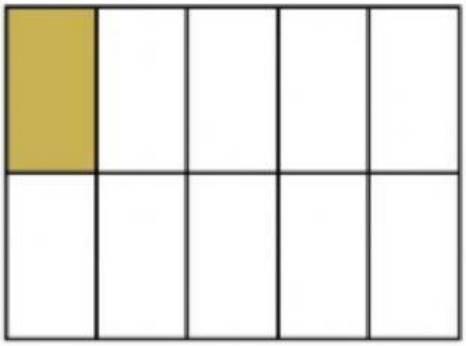

LIVEWORKSHEETS