Paralelograms

Paralelograma ..... malas ir pa .....

..... un .....

Pretējie leņķi ir .....

Diagonāles ..... dalās .....

Blakusleņķu ..... ir ..... grādi.

Romba ..... malas ir .....

Pretējie ..... ir .....

Diagonāles ir ..... un krustpunktā dalās .....

Blakusleņķu ..... ir ..... grādi.



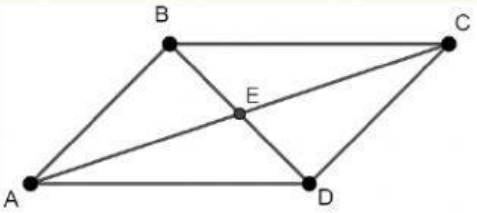

Nosauc lielumus!

- Diagonāles:
- vienādās malas: AB= AD=
- Leņķi: $\sphericalangle CAD = \sphericalangle$

  $\sphericalangle BEA = \sphericalangle$

Aprēķini nezināmos leņķus! (saliec virsotnēs burtus)

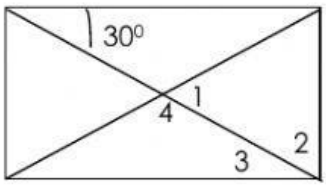

$\sphericalangle 1 =$

$\sphericalangle 2 =$

$\sphericalangle 3 =$

$\sphericalangle 4 =$

Aprēķini paralelograma leņķus!

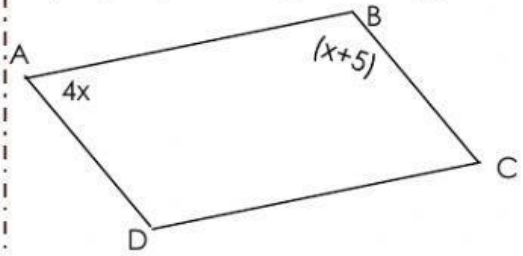

$\sphericalangle A =$

$\sphericalangle B =$

Atrodi nezināmos leņķus!

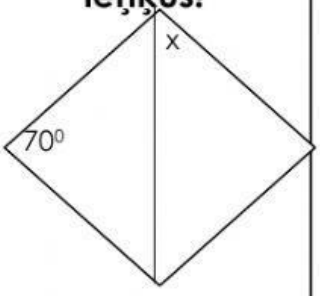

$x =$ °



$y =$ °

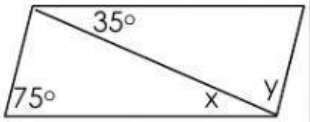

$x =$ °

$y =$ °

LIVEWORKSHEETS