CORPORACIÓN MUNICIPAL DE EDUCACIÓN Y SALUD DE LAS CONDES
COLEGIO LEONARDO DA VINCI
2° BÁSICO

IDENTIFICAR Y REPRESENTAR NÚMEROS HASTA EL 100 (2)

1. Lee el número dado e identifícalo en el grupo a su derecha, encerrándolo en un círculo.

Veintitrés	13	23	53	66	24
Cuarenta y cinco	45	55	67	29	80
Treinta	80	13	23	30	35
Diecisiete	70	48	17	18	27
Ochenta y dos	28	80	18	30	82

2. Selecciona la representación correcta para cada número.

Número	Representación	
48	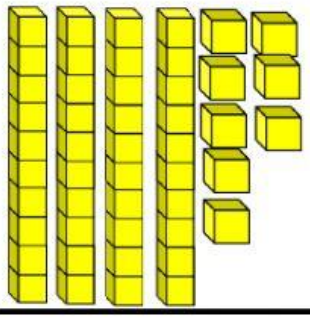	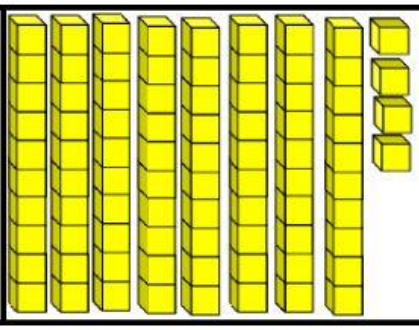

LIVEWORKSHEETS

21	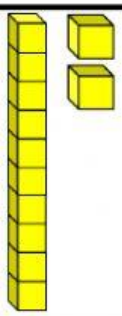	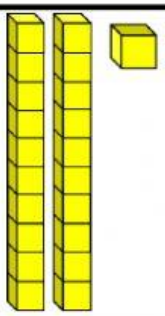
37	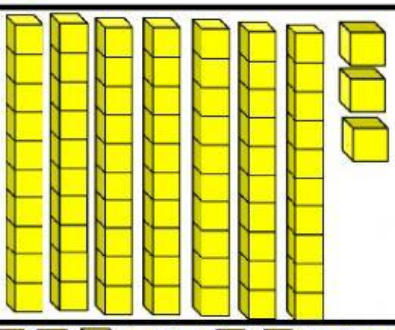	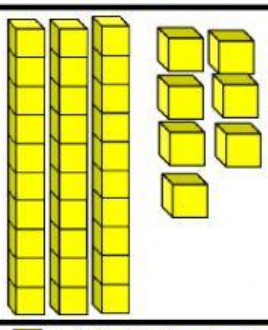
69	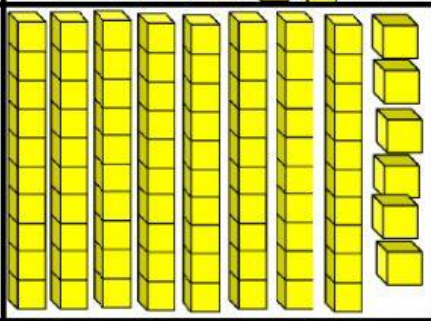	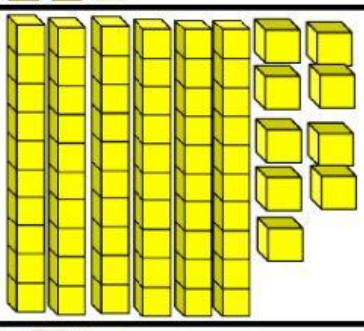
81	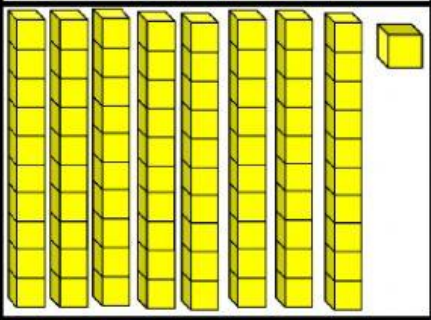	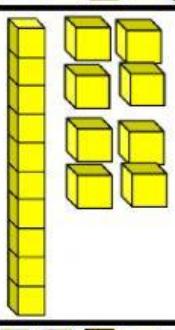
19	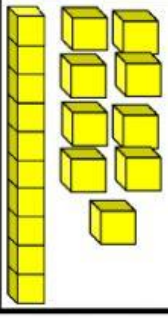	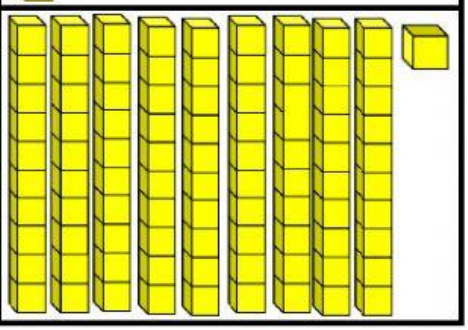

LIVEWORKSHEETS

3. Une con una línea cada número con su representación, y luego con su escritura.

23	Cuarenta y dos
17	Cincuenta
42	Veintitrés
66	Treinta y cinco
50	Sesenta y seis
35	Diecisiete

LIVEWORKSHEETS

LIVEWORKSHEETS