Measuring Mass in Grams

Write the mass of each piece of fruit. Remember to write the units!

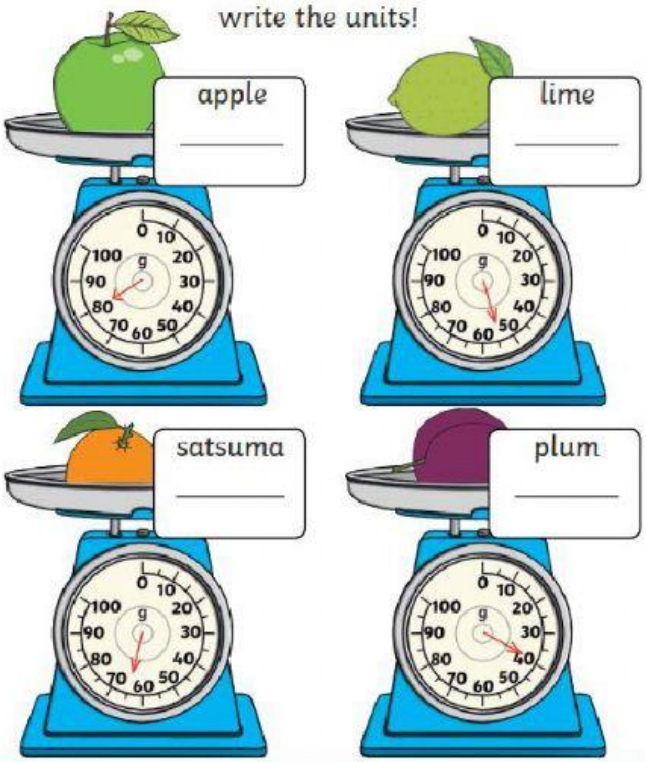

Order the fruits from lightest to heaviest.

_____ _____ _____ _____

Measuring Mass in Grams

Adam is measuring the mass of two pencil cases.

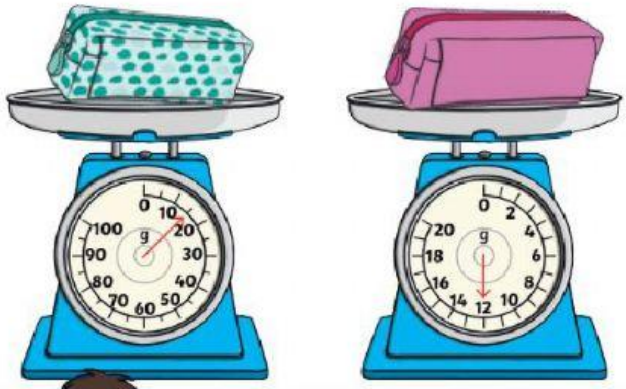

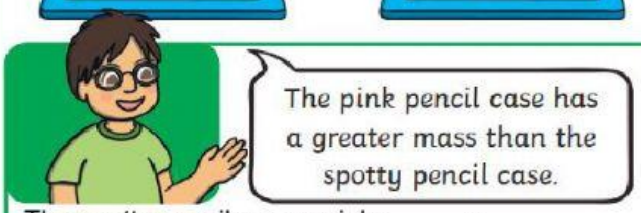

The spotty pencil case weighs ____ g.
The pink pencil case weighs ____ g.
The spotty pencil case is _____ than the pink pencil case.

Can you find two items in your classroom to measure in grams? What is the difference between their masses?

LIVEWORKSHEETS

Measuring Mass in Grams

A large tin of beans has a mass of 100g.

What is the mass of a small tin?



Crisps have a mass of 50g.

Nuts have a mass of 70g.

What is the mass of the raisins?

Use a 100g weight to help you find three things in the classroom that you think feel lighter than 100g. Use a scale to check.

Measuring Mass in Kilograms

A family measure their masses on some bathroom scales.

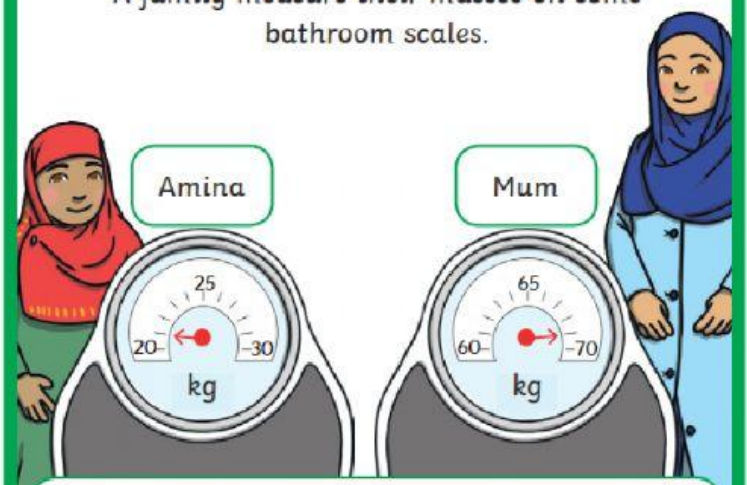

What is Mum's mass?

How heavy is Amina?

Omar's mass is 6kg more than his sister. What is his mass?

Dad is 20kg heavier than Mum. What is Dad's mass?

Omar's friend, Fola, weighs more than Amina but less than Omar. What could Fola's mass be?

LIVEWORKSHEETS