الوحدة 1

الدرس II: الحدود الجمعية الناقصة

○ أوجد الحد الجمعي الناقص. ارسمه على هيئة عدة نقاط على قطعة الدومينو.



$\square + 6 = 13$



$6 + \square = 8$



$3 + \square = 10$



$6 + \square = 15$

$15 - 6 = \square$



$\square + 9 = 11$

$11 - 9 = \square$



$8 + \square = 16$

$16 - 8 = \square$

$9 + \square = 16$

$16 - 9 = \square$

$\square + 5 = 10$

$10 - 5 = \square$

$6 + \square = 6$

$6 - 6 = \square$

$6 + \square = 11$

$11 - 6 = \square$

$\square + 7 = 14$

$14 - 7 = \square$

$4 + \square = 13$

$13 - 4 = \square$

$6 + \square = 12$

$12 - 6 = \square$

$\square + 8 = 8$

$8 - 8 = \square$

$4 + \square = 7$

$7 - 4 = \square$

LIVEWORKSHEETS